Name _____ Date _____

Geography · Practice paper

Geography Practice Paper (1)

Answer every question. Show your working where you can. Mark it out of 102.

Score: _____ / 102

★ 0 to 50 keep practising ★★ 51 to 79 good work ★★★ 80 to 102 super!

sunny | rainy | snowy | foggy

1. Write what each weather symbol means. (4 marks)



1. _____



2. _____



3. _____

4. _____

2. Read the weather map: Karachi 24 °C, Skardu −5 °C, Lahore 18 °C, Quetta 8 °C. Circle. (3 marks)

1. Which city is colder? Karachi | Skardu
2. Which city may have snow? Skardu | Karachi
3. How much warmer is Lahore than Quetta? 10 °C | 26 °C

3. True or false? Circle. (2 marks)

1. A weather map uses symbols. True | False
2. The weather is the same every day. True | False

Name _____ Date _____

Geography · Practice paper

Geography Practice Paper (2)

Pakistan has some of the highest mountains in the world.



Mountains of Pakistan

Most of our high mountains are in the north. The snow leopard and the markhor, our national animal, live there.

4. Circle the right answer. (4 marks)

1. K2 is the ... highest mountain in the world. second tenth
2. K2 is in the ... range. Kirthar Karakoram
3. Our national animal is the ... markhor camel
4. The snow leopard lives in ... deserts high mountains

Karakoram **Himalayas** **Hindu Kush**

5. Three great ranges meet in the north. Fill in. (3 marks)

1. the _____, the _____ and the _____

6. Match the part of a mountain. Write the letter in the box. (3 marks)

☐	1. peak	a)	the side of the mountain
☐	2. slope	b)	the top of the mountain
☐	3. foot	c)	the bottom of the mountain

Name _____ Date _____

Geography · Practice paper

Geography Practice Paper (3)

Rivers, lakes and farms.

7. Circle the right answer. (4 marks)

1. The longest river in Pakistan is the … — Indus / Ravi
2. The Indus ends in the … — Arabian Sea / Lake Saiful Muluk
3. Punjab means the land of five … — mountains / rivers
4. A lake has … all around it. — sea / land



Farming

Rabi crops are sown in winter and cut in spring, like wheat. Kharif crops are sown in summer and cut in autumn, like rice and cotton.

8. Rabi or kharif? Circle. (3 marks)

1. wheat — rabi (winter) / kharif (summer)
2. rice — rabi (winter) / kharif (summer)
3. cotton — rabi (winter) / kharif (summer)

dams **Sindh** **roti**

9. Fill in. (3 marks)

1. Tarbela and Mangla are big _____.
2. Most farms are in Punjab and _____.
3. Wheat is ground into flour to make _____.

Name _____ Date _____

Geography · Practice paper

Geography Practice Paper (4)

Winter is not the same everywhere. Keep going: this paper has ten pages.

10. Circle the right answer. (4 marks)

1. In December it is winter in … Pakistan / Australia
2. In December it is summer in … Pakistan / Australia
3. The line around the middle of the Earth is the … Equator / North Pole
4. Near the Equator it is … snowy all year / warm all year

11. Circle the right answer. (2 marks)

1. Polar bears live in the … Sahara / Arctic
2. Some birds fly to warmer places in winter. This is called … migration / hibernation

12. Cold or warm in December? Circle. (3 marks)

1. Skardu, Pakistan cold / warm
2. Sydney, Australia cold / warm
3. Moscow, Russia cold / warm

13. Write a postcard from a snowy place. Write three sentences. (3 marks)

Name _____ Date _____

Geography · Practice paper

Geography Practice Paper (5)

Read the weather map. North is at the top.

North

Chitral	Gilgit	Skardu
Peshawar	Islamabad	Lahore
Quetta	Multan	Bahawalpur

West East

South

14. Use the map. Circle. (5 marks)

1. What is the weather in Lahore? foggy sunny
2. Which town is north of Islamabad? Gilgit Multan
3. Which town is west of Islamabad? Lahore Peshawar
4. Is it rainy in Islamabad? yes no
5. Which row is snowy? the top row the bottom row

15. Which town would you visit today? Why? (2 marks)

_____

Name _____ Date _____

Geography · Practice paper

Geography Practice Paper (6)

Our high mountains in the north.

K2 | 8,611 | Nanga Parbat | glaciers

16. Fill in. (4 marks)

1. The highest mountain in Pakistan is _____.
2. K2 is _____ metres high.
3. _____ is another very high mountain.
4. Big rivers of ice in the mountains are called _____.

17. Does it live in the high mountains? Circle. (4 marks)

1.	 snow leopard	yes	no
2.	 markhor	yes	no
3.	 camel	yes	no
4.	 crocodile	yes	no

18. Mountain maths. (3 marks)

1. A climber goes up 300 m each day. In 3 days she goes up _____ m.

2. A road has 25 bends. A car has passed 17. _____ bends are left.

3. A jeep carries 4 people. 5 jeeps carry _____ people.

Name _____ Date _____

Geography · Practice paper

Geography Practice Paper (7)

Rivers flow from the mountains to the sea.

glacier | plains | Arabian Sea

19. A river's journey. Fill in. (3 marks)



→



Snow and a _____ melt The river runs down to the _____

→



It reaches the _____

20. Match the lake or dam to where it is. Write the letter in the box. (4 marks)

☐	1. Lake Saiful Muluk	a)	Sindh, near Thatta
☐	2. Keenjhar Lake	b)	Kaghan Valley
☐	3. Tarbela Dam	c)	on the Jhelum River
☐	4. Mangla Dam	d)	on the Indus River

21. True or false? Circle. (3 marks)

1. Dams store water for farms.	True	False
2. We should throw rubbish in rivers.	True	False
3. The Indus starts in the mountains.	True	False

Name _____ Date _____

Geography · Practice paper

Geography Practice Paper (8)

Pakistan is a farming country.

22. Name the crop or fruit. Circle. (4 marks)

1.  crop 1 — rice | maize | mango | orange
2.  crop 2 — rice | maize | mango | orange
3.  fruit 1 — rice | maize | mango | orange
4.  fruit 2 — rice | maize | mango | orange

sow **harvest** **mill** **roti**

23. From seed to roti. Fill in. (4 marks)



Farmers _____ wheat seeds



They _____ the wheat in spring



The _____ grinds it into flour



We make _____

24. Circle the right answer. (2 marks)

1. Most farms are in Punjab and … — Sindh | Gilgit
2. Farms need water from … — rivers and canals | the sea

Name _____ Date _____

Geography · Practice paper

Geography Practice Paper (9)

Winter is different around the world.

25. Match the place to its December weather. Write the letter in the box. (4 marks)

☐	1. Skardu	a)	mild and sunny
☐	2. Karachi	b)	snowy and very cold
☐	3. Sydney, Australia	c)	ice and snow all winter, little daylight
☐	4. the Arctic	d)	hot summer days

26. Circle the right answer. (4 marks)

1. When it is winter in Pakistan, it is summer in … — Australia / China
2. Animals that sleep through winter … — migrate / hibernate
3. The Equator is … — around the middle of the Earth / at the North Pole
4. The Earth is … — tilted / flat

27. Is it for a snowy winter day? Circle. (4 marks)

1.  scarf — yes / no
2.  shorts — yes / no
3.  gloves — yes / no
4.  beach sunglasses — yes / no

Name _____ Date _____

Geography · Practice paper

Geography Practice Paper (10)

Think about all five topics. Add up your marks from all ten pages.

28. Spot the mistake. Right or wrong? Circle. (4 marks)

1. K2 is in the Karakoram. right wrong
2. The Indus ends in a desert. right wrong
3. Wheat is a rabi crop. right wrong
4. In December it is summer in Pakistan. right wrong

29. Which is the odd one out? Circle. (3 marks)

1. K2 Indus Jhelum
2. wheat Tarbela rice
3. sunny rainy markhor

30. True or false? Circle. (2 marks)

1. A lake has land all around it. True False
2. Rice is sown in winter. True False

31. Draw or write: what would you see on a trip from the mountains to the sea? Write two things. (2 marks)

1. _____ 2. _____

How did I do?

I can _____ . I will practise _____ .

ANSWER KEY

Name _____ Date _____

Geography · Practice paper

Geography Practice Paper (1)

Answer every question. Show your working where you can. Mark it out of 102.

Score: _____ / 102

★ 0 to 50 keep practising ★★ 51 to 79 good work ★★★ 80 to 102 super!

sunny | rainy | snowy | foggy

1. Write what each weather symbol means. (4 marks)



1. sunny



2. rainy



3. snowy

4. foggy

2. Read the weather map: Karachi 24 °C, Skardu −5 °C, Lahore 18 °C, Quetta 8 °C. Circle. (3 marks)

1. Which city is colder? Karachi **Skardu**
2. Which city may have snow? **Skardu** Karachi
3. How much warmer is Lahore than Quetta? **10 °C** 26 °C

3. True or false? Circle. (2 marks)

1. A weather map uses symbols. **True** False
2. The weather is the same every day. True **False**

ANSWER KEY

Name _____ Date _____

Geography · Practice paper

Geography Practice Paper (2)

Pakistan has some of the highest mountains in the world.



Mountains of Pakistan

Most of our high mountains are in the north. The snow leopard and the markhor, our national animal, live there.

4. Circle the right answer. (4 marks)

1. K2 is the … highest mountain in the world. **second** tenth
2. K2 is in the … range. Kirthar **Karakoram**
3. Our national animal is the … **markhor** camel
4. The snow leopard lives in … deserts **high mountains**

Karakoram **Himalayas** **Hindu Kush**

5. Three great ranges meet in the north. Fill in. (3 marks)

1. the **Karakoram** , the **Himalayas** and the **Hindu Kush**

6. Match the part of a mountain. Write the letter in the box. (3 marks)

b	1. peak	a)	the side of the mountain
a	2. slope	b)	the top of the mountain
c	3. foot	c)	the bottom of the mountain

ANSWER KEY

Name _____ Date _____

Geography · Practice paper

Geography Practice Paper (3)

Rivers, lakes and farms.

7. Circle the right answer. (4 marks)

1. The longest river in Pakistan is the … **Indus** Ravi
2. The Indus ends in the … **Arabian Sea** Lake Saiful Muluk
3. Punjab means the land of five … mountains **rivers**
4. A lake has … all around it. sea **land**



Farming

Rabi crops are sown in winter and cut in spring, like wheat. Kharif crops are sown in summer and cut in autumn, like rice and cotton.

8. Rabi or kharif? Circle. (3 marks)

1. wheat **rabi (winter)** kharif (summer)
2. rice rabi (winter) **kharif (summer)**
3. cotton rabi (winter) **kharif (summer)**

dams **Sindh** **roti**

9. Fill in. (3 marks)

1. Tarbela and Mangla are big **dams** .
2. Most farms are in Punjab and **Sindh** .
3. Wheat is ground into flour to make **roti** .

ANSWER KEY

Name _____ Date _____

Geography · Practice paper

Geography Practice Paper (4)

Winter is not the same everywhere. Keep going: this paper has ten pages.

10. Circle the right answer. (4 marks)

1. In December it is winter in … **Pakistan** / Australia
2. In December it is summer in … Pakistan / **Australia**
3. The line around the middle of the Earth is the … **Equator** / North Pole
4. Near the Equator it is … snowy all year / **warm all year**

11. Circle the right answer. (2 marks)

1. Polar bears live in the … Sahara / **Arctic**
2. Some birds fly to warmer places in winter. This is called … **migration** / hibernation

12. Cold or warm in December? Circle. (3 marks)

1. Skardu, Pakistan **cold** / warm
2. Sydney, Australia cold / **warm**
3. Moscow, Russia **cold** / warm

13. Write a postcard from a snowy place. Write three sentences. (3 marks)

Answers will vary.

ANSWER KEY

Name _____ Date _____

Geography · Practice paper

Geography Practice Paper (5)

Read the weather map. North is at the top.

North

West

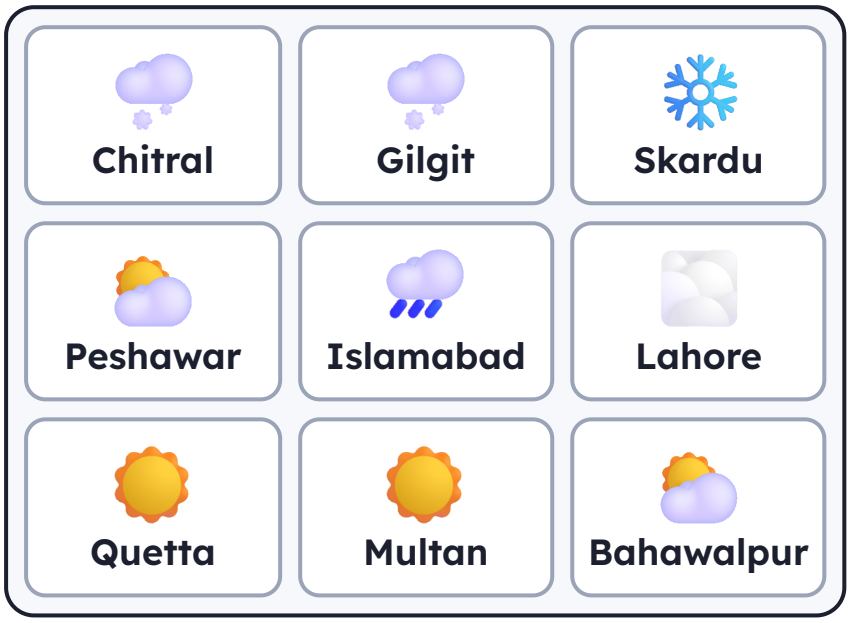

East

South

14. Use the map. Circle. (5 marks)

1. What is the weather in Lahore? **foggy** sunny
2. Which town is north of Islamabad? **Gilgit** Multan
3. Which town is west of Islamabad? Lahore **Peshawar**
4. Is it rainy in Islamabad? **yes** no
5. Which row is snowy? **the top row** the bottom row

15. Which town would you visit today? Why? (2 marks)

Answers will vary.

ANSWER KEY

Name _____ Date _____

Geography · Practice paper

Geography Practice Paper (6)

Our high mountains in the north.

K2 | 8,611 | Nanga Parbat | glaciers

16. Fill in. (4 marks)

1. The highest mountain in Pakistan is **K2** .
2. K2 is **8,611** metres high.
3. **Nanga Parbat** is another very high mountain.
4. Big rivers of ice in the mountains are called **glaciers** .

17. Does it live in the high mountains? Circle. (4 marks)

1.	snow leopard	**yes**	no
2.	markhor	**yes**	no
3.	camel	yes	**no**
4.	crocodile	yes	**no**

18. Mountain maths. (3 marks)

1. A climber goes up 300 m each day. In 3 days she goes up **900** m.
2. A road has 25 bends. A car has passed 17. **8** bends are left.
3. A jeep carries 4 people. 5 jeeps carry **20** people.

ANSWER KEY

Name _____ Date _____

Geography · Practice paper

Geography Practice Paper (7)

Rivers flow from the mountains to the sea.

glacier | plains | Arabian Sea

19. A river's journey. Fill in. (3 marks)





Snow and a **glacier** melt The river runs down to the **plains**



It reaches the **Arabian Sea**

20. Match the lake or dam to where it is. Write the letter in the box. (4 marks)

b	1. Lake Saiful Muluk	a)	Sindh, near Thatta
a	2. Keenjhar Lake	b)	Kaghan Valley
d	3. Tarbela Dam	c)	on the Jhelum River
c	4. Mangla Dam	d)	on the Indus River

21. True or False? Circle. (3 marks)

1. Dams store water for farms. **True** False
2. We should throw rubbish in rivers. True **False**
3. The Indus starts in the mountains. **True** False

ANSWER KEY

Name _____ Date _____

Geography · Practice paper

Geography Practice Paper (8)

Pakistan is a farming country.

22. Name the crop or fruit. Circle. (4 marks)

1.  crop 1 — **rice** | maize | mango | orange
2.  crop 2 — rice | **maize** | mango | orange
3.  fruit 1 — rice | maize | **mango** | orange
4.  fruit 2 — rice | maize | mango | **orange**

sow **harvest** **mill** **roti**

23. From seed to roti. Fill in. (4 marks)



Farmers **sow** wheat seeds



They **harvest** the wheat in spring



The **mill** grinds it into flour



We make **roti**

24. Circle the right answer. (2 marks)

1. Most farms are in Punjab and … — **Sindh** | Gilgit
2. Farms need water from … — **rivers and canals** | the sea

ANSWER KEY

Name _____ Date _____

Geography · Practice paper

Geography Practice Paper (9)

Winter is different around the world.

25. Match the place to its December weather. Write the letter in the box. (4 marks)

b	1. Skardu	a)	mild and sunny
a	2. Karachi	b)	snowy and very cold
d	3. Sydney, Australia	c)	ice and snow all winter, little daylight
c	4. the Arctic	d)	hot summer days

26. Circle the right answer. (4 marks)

1. When it is winter in Pakistan, it is summer in ... — **Australia** / China
2. Animals that sleep through winter ... — migrate / **hibernate**
3. The Equator is ... — **around the middle of the Earth** / at the North Pole
4. The Earth is ... — **tilted** / flat

27. Is it for a snowy winter day? Circle. (4 marks)

1.  scarf — **yes** / no
2.  shorts — yes / **no**
3.  gloves — **yes** / no
4.  beach sunglasses — yes / **no**

ANSWER KEY

Name _____ Date _____

Geography · Practice paper

Geography Practice Paper (10)

Think about all five topics. Add up your marks from all ten pages.

28. Spot the mistake. Right or wrong? Circle. (4 marks)

1. K2 is in the Karakoram. **right** wrong
2. The Indus ends in a desert. right **wrong**
3. Wheat is a rabi crop. **right** wrong
4. In December it is summer in Pakistan. right **wrong**

29. Which is the odd one out? Circle. (3 marks)

1. **K2** Indus Jhelum
2. wheat **Tarbela** rice
3. sunny rainy **markhor**

30. True or false? Circle. (2 marks)

1. A lake has land all around it. **True** False
2. Rice is sown in winter. True **False**

31. Draw or write: what would you see on a trip from the mountains to the sea? Write two things. (2 marks)

1. _____ 2. _____

Answers will vary.

How did I do?

I can _____ . I will practise _____ .

Answers will vary.