Name _____ Date _____

Maths · Numbers to 1000

Hundreds, Tens and Ones

Write the hundreds, tens and ones.

1. 345 = _____ hundreds _____ tens _____ ones

2. 708 = _____ hundreds _____ tens _____ ones

3. 162 = _____ hundred _____ tens _____ ones

Write the number.

1. 4 hundreds 2 tens 6 ones = _____

2. 8 hundreds 0 tens 3 ones = _____

3. 5 hundreds 5 tens 0 ones = _____

Name _____ Date _____

Maths · Adding and subtracting

Add with Regrouping

Add. Carry when the ones make 10 or more.

When the ones add up to 10 or more, carry 1 ten to the tens.

1. 38 + 25 = _____

2. 47 + 36 = _____

3. 59 + 14 = _____

4. 126 + 48 = _____

5. 275 + 117 = _____

6. 408 + 293 = _____

Name _____ Date _____

Maths · Multiplying by 2, 5 and 10

Groups Of

Write how many in all.

1. 4 groups of 5 = _____

2. 3 groups of 10 = _____

3. 6 groups of 2 = _____

4. 7 groups of 5 = _____

5. 5 groups of 10 = _____

6. 9 groups of 2 = _____

More free worksheets **littletakhti.netlify.app**

Name _____ Date _____

Maths · Money and shopping

Count the Money

Add the notes and coins.

1. Rs 50 + Rs 20 + Rs 10 = Rs _____

2. Rs 100 + Rs 50 = Rs _____

3. Rs 500 + Rs 100 + Rs 100 = Rs _____

4. Rs 20 + Rs 20 + Rs 5 = Rs _____

5. Rs 100 + Rs 10 + Rs 2 = Rs _____

6. Rs 50 + Rs 50 + Rs 50 = Rs _____

Name _____ Date _____

Maths · Time and calendar

Quarter Past and To

Write the time.

1.

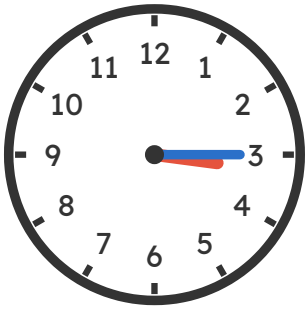

2.



3.

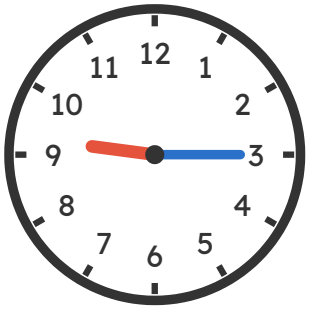

4.



5.



6.



Name _____ Date _____

Maths · Length, mass and capacity

Which Unit?

Circle the best unit.

1. the length of a room — metres / kilograms

2. the weight of a bag of rice — litres / kilograms

3. the water in a bucket — litres / metres

4. the height of a door — metres / litres

5. the weight of a watermelon — kilograms / metres

6. the milk in a jug — litres / kilograms

More free worksheets **littletakhti.netlify.app**

Name _____ Date _____

Maths · Shapes and symmetry

Faces, Edges, Corners

Fill in the blanks.

1. A cube has _____ faces.

2. A cuboid has _____ faces.

3. A cone has _____ flat face.

4. A sphere has _____ corners.

More free worksheets **littletakhti.netlify.app**

Name _____ Date _____

Maths · Halves and quarters

Halves and Quarters

What fraction is shaded?

1. 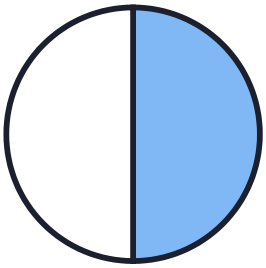

2. 

3. 

4. 

Name _____ Date _____

Maths · Pictographs

Read the Pictograph

Use the pictograph to answer.

Pets in Class 2. Each ● = 1 child.

Cat: ● ● ● ● ●

Parrot: ● ● ●

Fish: ● ●

Rabbit: ● ● ● ●

1. How many have a cat? _____

2. How many have a fish? _____

3. Which pet is most popular? _____

4. How many more cats than parrots? _____

More free worksheets **littletakhti.netlify.app**

Name _____ Date _____

Maths · Sharing and division

Share Equally

Share equally. How many each?

1. 10 sweets shared by 2 children: _____ each

2. 12 marbles shared by 3 children: _____ each

3. 8 apples shared by 4 children: _____ each

4. 20 pencils shared by 5 children: _____ each

More free worksheets **littletakhti.netlify.app**

ANSWER KEY

Name _____ Date _____

Maths · Numbers to 1000

Hundreds, Tens and Ones

Write the hundreds, tens and ones.

1. 345 = 3 hundreds 4 tens 5 ones
2. 708 = 7 hundreds 0 tens 8 ones
3. 162 = 1 hundred 6 tens 2 ones

Write the number.

1. 4 hundreds 2 tens 6 ones = 426
2. 8 hundreds 0 tens 3 ones = 803
3. 5 hundreds 5 tens 0 ones = 550

ANSWER KEY

Name _____ Date _____

Maths · Adding and subtracting

Add with Regrouping

Add. Carry when the ones make 10 or more.

When the ones add up to 10 or more, carry 1 ten to the tens.

1. 38 + 25 = **63**

2. 47 + 36 = **83**

3. 59 + 14 = **73**

4. 126 + 48 = **174**

5. 275 + 117 = **392**

6. 408 + 293 = **701**

ANSWER KEY

Name _____ Date _____

Maths · Multiplying by 2, 5 and 10

Groups Of

Write how many in all.

1. 4 groups of 5 = **20**
2. 3 groups of 10 = **30**
3. 6 groups of 2 = **12**
4. 7 groups of 5 = **35**
5. 5 groups of 10 = **50**
6. 9 groups of 2 = **18**

ANSWER KEY

Name _____ Date _____

Maths · Money and shopping

Count the Money

Add the notes and coins.

1. Rs 50 + Rs 20 + Rs 10 = Rs **80**

2. Rs 100 + Rs 50 = Rs **150**

3. Rs 500 + Rs 100 + Rs 100 = Rs **700**

4. Rs 20 + Rs 20 + Rs 5 = Rs **45**

5. Rs 100 + Rs 10 + Rs 2 = Rs **112**

6. Rs 50 + Rs 50 + Rs 50 = Rs **150**

ANSWER KEY

Name _____ Date _____

Maths · Time and calendar

Quarter Past and To

Write the time.

1.

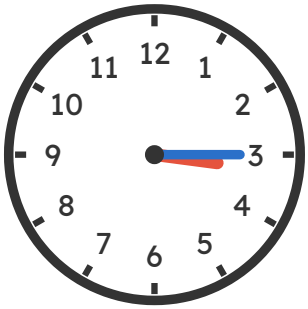

quarter past 3

2.



quarter to 7

3.

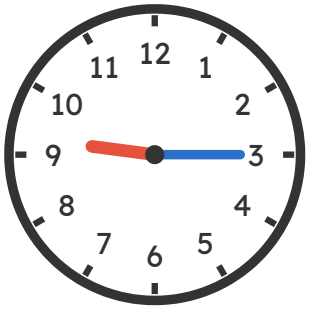

quarter past 9

4.



quarter to 12

5.



half past 1

6.



4 o'clock

ANSWER KEY

Name _____ Date _____

Maths · Length, mass and capacity

Which Unit?

Circle the best unit.

1. the length of a room — **metres** / kilograms
2. the weight of a bag of rice — litres / **kilograms**
3. the water in a bucket — **litres** / metres
4. the height of a door — **metres** / litres
5. the weight of a watermelon — **kilograms** / metres
6. the milk in a jug — **litres** / kilograms

ANSWER KEY

Name _____ Date _____

Maths · Shapes and symmetry

Faces, Edges, Corners

Fill in the blanks.

1. A cube has **6** faces.

2. A cuboid has **6** faces.

3. A cone has **1** flat face.

4. A sphere has **0** corners.

ANSWER KEY

Name _____ Date _____

Maths · Halves and quarters

Halves and Quarters

What fraction is shaded?

1. 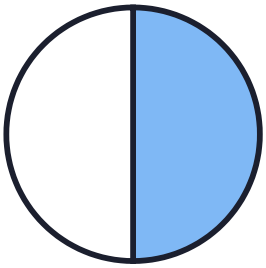 **1/2**

2.  **1/4**

3.  **1/2**

4.  **2/4**

More free worksheets **littletakhti.netlify.app**

ANSWER KEY

Name _____ Date _____

Maths · Pictographs

Read the Pictograph

Use the pictograph to answer.

Pets in Class 2. Each ● = 1 child.

Cat: ● ● ● ● ●

Parrot: ● ● ●

Fish: ● ●

Rabbit: ● ● ● ●

1. How many have a cat? **5**

2. How many have a fish? **2**

3. Which pet is most popular? **Cat**

4. How many more cats than parrots? **2**

More free worksheets **littletakhti.netlify.app**

ANSWER KEY

Name _____ Date _____

Maths · Sharing and division

Share Equally

Share equally. How many each?

1. 10 sweets shared by 2 children: 5 each

2. 12 marbles shared by 3 children: 4 each

3. 8 apples shared by 4 children: 2 each

4. 20 pencils shared by 5 children: 4 each

More free worksheets **littletakhti.netlify.app**