Name _____ Date _____

Maths · Multiplication and division

# Times Tables 3 and 4

Solve.

**1.** 3 × 4 = _____ **2.** 6 × 3 = _____ **3.** 8 × 4 = _____

**4.** 7 × 3 = _____ **5.** 9 × 4 = _____ **6.** 4 × 4 = _____

**7.** 9 × 3 = _____ **8.** 6 × 4 = _____ **9.** 10 × 3 = _____



More free worksheets **littletakhti.netlify.app**

Name _____ Date _____

Maths · Fractions

# Halves, Thirds, Quarters

Write the fraction that is shaded.

1. 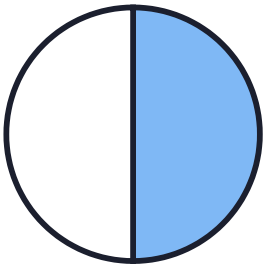

2. 

3. 

4. 

5. 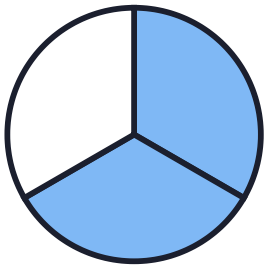

6. 

Name _____ Date _____

Maths · Bar models

# Part-Whole Bar Models

Find the missing number in each bar.

**1.**

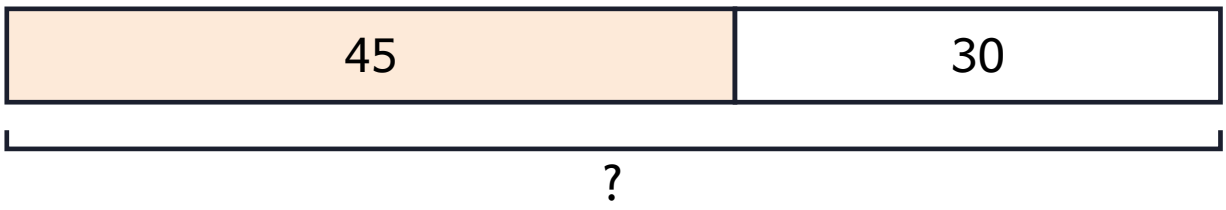


**2.**

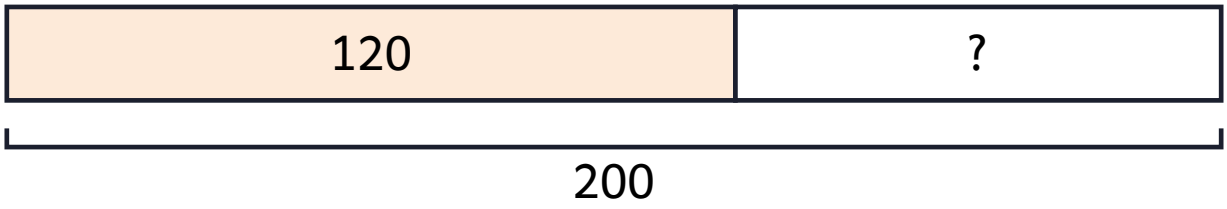


**3.**

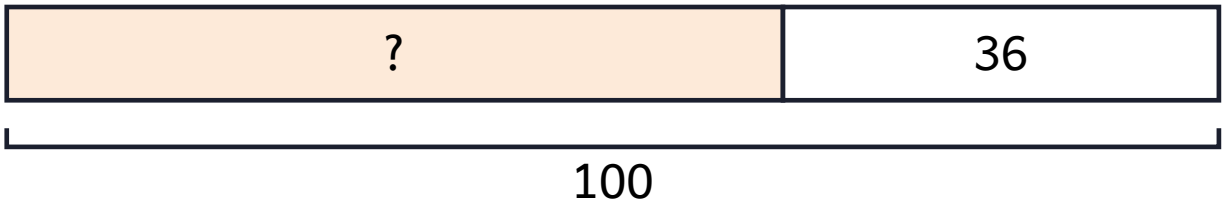


## Write the number sentence.

**1.** 45 + 30 = _____

**2.** 200 − 120 = _____

Name _____ Date _____

Maths · Measurement

# Units of Length

Convert the units.

1 metre = 100 centimetres. 1 kilometre = 1000 metres.

**1.** 2 m = _____ cm

**2.** 5 m = _____ cm

**3.** 300 cm = _____ m

**4.** 1 km = _____ m

**5.** 3 km = _____ m

**6.** 700 cm = _____ m



More free worksheets **littletakhti.netlify.app**

Name _____ Date _____

Maths · Data handling

# Pictograph

Read the pictograph. Answer the questions.

Favourite fruits in Grade 3. Each ● = 2 children.

Mango: ● ● ● ● ●

Banana: ● ● ●

Apple: ● ● ● ●

Guava: ● ●

1. How many children like mango? _____

2. How many like guava? _____

3. Which fruit is liked most? _____

4. How many more like apple than guava? _____



More free worksheets **littletakhti.netlify.app**

Name _____ Date _____

Maths · Angles and perimeter

# Right Angles

Is it a right angle? Circle yes or no.

1. the corner of a book — yes no
2. the corner of a square — yes no
3. an open pair of scissors — yes no
4. the corner of a door — yes no
5. a slice of pizza — yes no



More free worksheets **littletakhti.netlify.app**

Name _____ Date _____

Maths · Place value to 10,000

# Thousands, Hundreds, Tens, Ones

Write the value.

1. 4,326 = _____ thousands _____ hundreds _____ tens _____ ones

2. 7,051 = _____ thousands _____ hundreds _____ tens _____ one

3. In 5,849 the digit 8 is worth _____



More free worksheets **littletakhti.netlify.app**

Name _____ Date _____

Maths · Adding and subtracting big numbers

# Add with Carrying

Solve.

1. 356 + 278 = _____

2. 1,245 + 368 = _____

3. 2,507 + 1,496 = _____

4. 478 + 525 = _____



More free worksheets **littletakhti.netlify.app**

Name _____ Date _____

Maths · Time and timetables

# a.m. and p.m.

Write a.m. or p.m.

1. breakfast at 7:30 a.m. p.m.

2. school ends at 1:30 a.m. p.m.

3. bedtime at 9:00 a.m. p.m.

4. Fajr prayer at 5:00 a.m. p.m.



More free worksheets **littletakhti.netlify.app**

Name _____ Date _____

Maths · Money and bills

# Read the Bill

Use the bill to answer.

Shop bill: Rice Rs 450, Oil Rs 620, Sugar Rs 280, Tea Rs 350

1. Total bill: Rs _____

2. Change from Rs 2,000: Rs _____

3. Which item costs most? _____



More free worksheets **littletakhti.netlify.app**

ANSWER KEY

Name _____ Date _____

Maths · Multiplication and division

# Times Tables 3 and 4

Solve.

1. 3 × 4 = 12
2. 6 × 3 = 18
3. 8 × 4 = 32
4. 7 × 3 = 21
5. 9 × 4 = 36
6. 4 × 4 = 16
7. 9 × 3 = 27
8. 6 × 4 = 24
9. 10 × 3 = 30



More free worksheets **littletakhti.netlify.app**

ANSWER KEY

Name _____ Date _____

Maths · Fractions

# Halves, Thirds, Quarters

Write the fraction that is shaded.

1. 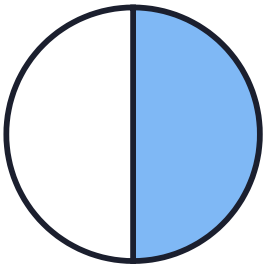 **1/2**

2.  **1/4**

3.  **3/4**

4.  **1/3**

5. 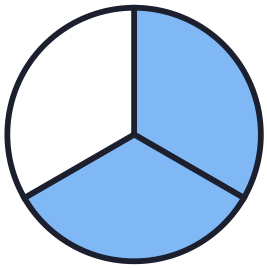 **2/3**

6.  **2/4**

ANSWER KEY

Name _____ Date _____

Maths · Bar models

# Part-Whole Bar Models

Find the missing number in each bar.

**1.**

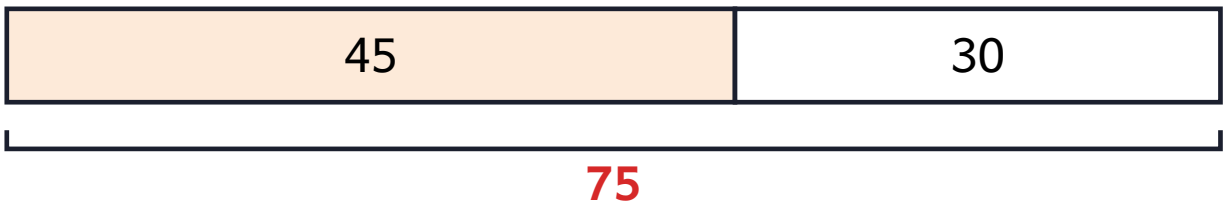


**2.**

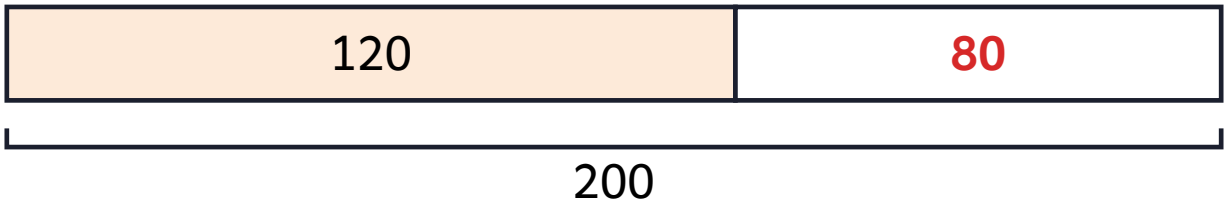


**3.**

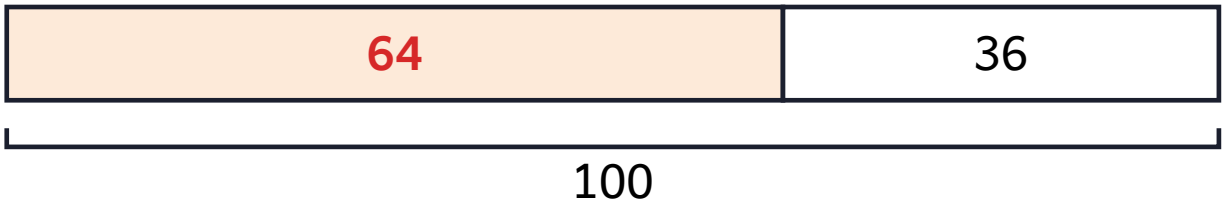


## Write the number sentence.

**1.** 45 + 30 = **75**

**2.** 200 − 120 = **80**

ANSWER KEY

Name _____ Date _____

Maths · Measurement

# Units of Length

Convert the units.

1 metre = 100 centimetres. 1 kilometre = 1000 metres.

1. 2 m = **200** cm

2. 5 m = **500** cm

3. 300 cm = **3** m

4. 1 km = **1000** m

5. 3 km = **3000** m

6. 700 cm = **7** m



More free worksheets **littletakhti.netlify.app**

ANSWER KEY

Name _____ Date _____

Maths · Data handling

# Pictograph

Read the pictograph. Answer the questions.

Favourite fruits in Grade 3. Each ● = 2 children.

Mango: ● ● ● ● ●

Banana: ● ● ●

Apple: ● ● ● ●

Guava: ● ●

1. How many children like mango? **10**

2. How many like guava? **4**

3. Which fruit is liked most? **Mango**

4. How many more like apple than guava? **4**

ANSWER KEY

Name _____ Date _____

Maths · Angles and perimeter

# Right Angles

Is it a right angle? Circle yes or no.

1. the corner of a book — **yes** / no
2. the corner of a square — **yes** / no
3. an open pair of scissors — yes / **no**
4. the corner of a door — **yes** / no
5. a slice of pizza — yes / **no**

ANSWER KEY

Name _____ Date _____

Maths · Place value to 10,000

# Thousands, Hundreds, Tens, Ones

Write the value.

1. 4,326 = **4** thousands **3** hundreds **2** tens **6** ones

2. 7,051 = **7** thousands **0** hundreds **5** tens **1** one

3. In 5,849 the digit 8 is worth **800**



More free worksheets **littletakhti.netlify.app**

ANSWER KEY

Name _____ Date _____

Maths · Adding and subtracting big numbers

# Add with Carrying

Solve.

1. 356 + 278 = 634

2. 1,245 + 368 = 1,613

3. 2,507 + 1,496 = 4,003

4. 478 + 525 = 1,003



More free worksheets **littletakhti.netlify.app**

ANSWER KEY

Name _____ Date _____

Maths · Time and timetables

# a.m. and p.m.

Write a.m. or p.m.

1. breakfast at 7:30 — **a.m.** / p.m.

2. school ends at 1:30 — a.m. / **p.m.**

3. bedtime at 9:00 — a.m. / **p.m.**

4. Fajr prayer at 5:00 — **a.m.** / p.m.

ANSWER KEY

Name _____ Date _____

Maths · Money and bills

# Read the Bill

Use the bill to answer.

Shop bill: Rice Rs 450, Oil Rs 620, Sugar Rs 280, Tea Rs 350

1. Total bill: Rs **1,700**

2. Change from Rs 2,000: Rs **300**

3. Which item costs most? **Oil**