Name _____ Date _____

Maths · Fractions

Halves, Thirds, Quarters

Write the fraction that is shaded.

1. 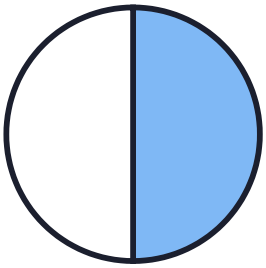

2. 

3. 

4. 

5. 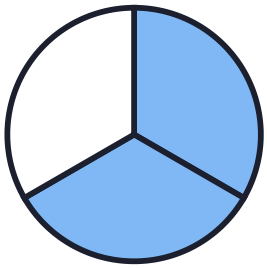

6. 

Name _____ Date _____

Maths · Fractions

Fraction of a Number

Find the fraction of each number.

1. ½ of 10 = _____

2. ½ of 16 = _____

3. ¼ of 8 = _____

4. ¼ of 20 = _____

5. ⅓ of 12 = _____

6. ⅓ of 9 = _____

More free worksheets **littletakhti.netlify.app**

Name _____ Date _____

Maths · Fractions

Compare Fractions

Circle the bigger fraction. Then solve.

1. ½ ¼

2. ⅓ ½

3. ¾ ¼

4. ⅔ ⅓

1. A roti is cut into 4 equal pieces. Ali eats 1 piece. What fraction did he eat? _____

2. Sara has 12 grapes and eats half. How many does she eat? _____

ANSWER KEY

Name _____ Date _____

Maths · Fractions

Halves, Thirds, Quarters

Write the fraction that is shaded.

1. 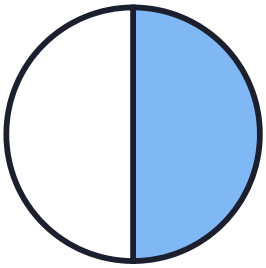 **1/2**

2.  **1/4**

3.  **3/4**

4.  **1/3**

5. 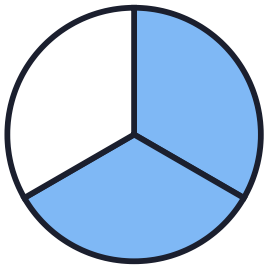 **2/3**

6.  **2/4**

ANSWER KEY

Name _____ Date _____

Maths · Fractions

Fraction of a Number

Find the fraction of each number.

1. ½ of 10 = 5

2. ½ of 16 = 8

3. ¼ of 8 = 2

4. ¼ of 20 = 5

5. ⅓ of 12 = 4

6. ⅓ of 9 = 3

More free worksheets **littletakhti.netlify.app**

ANSWER KEY

Name _____ Date _____

Maths · Fractions

Compare Fractions

Circle the bigger fraction. Then solve.

1. **1/2** 1/4

2. 1/3 **1/2**

3. **3/4** 1/4

4. **2/3** 1/3

1. A roti is cut into 4 equal pieces. Ali eats 1 piece. What fraction did he eat? **1/4**

2. Sara has 12 grapes and eats half. How many does she eat? **6**

More free worksheets **littletakhti.netlify.app**