Name _____ Date _____

Maths · Bar models

Part-Whole Bar Models

Find the missing number in each bar.

1.

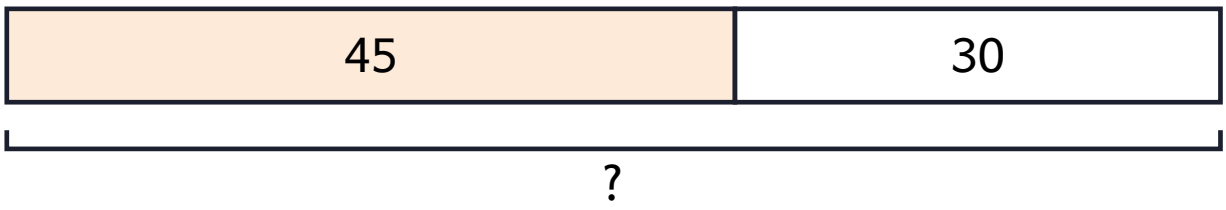

2.

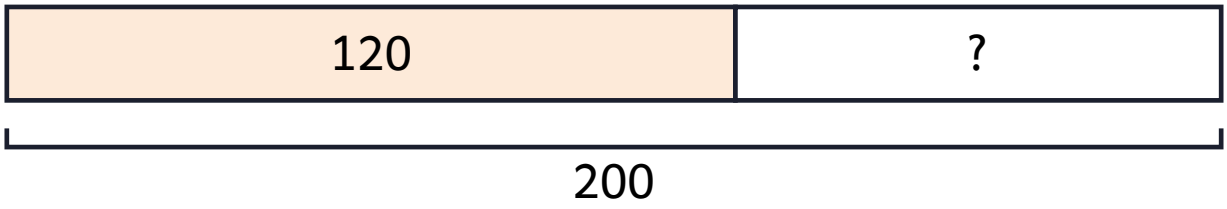

3.

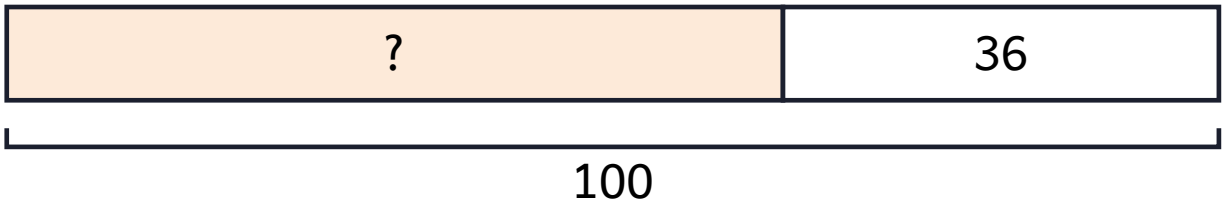

Write the number sentence.

1. 45 + 30 = _____

2. 200 − 120 = _____

Name _____ Date _____

Maths · Bar models

Comparison Problems

Draw a bar model to help you.

1. Ali has 35 marbles. Bilal has 12 more than Ali. How many does Bilal have? _____

2. A red ribbon is 90 cm long. A blue ribbon is 25 cm shorter. How long is the blue ribbon? _____ cm

3. Sara read 48 pages. Zara read 60 pages. How many more pages did Zara read? _____

More free worksheets **littletakhti.netlify.app**

Name _____ Date _____

Maths · Bar models

Two-Step Problems

Draw a bar model, then solve.

1. A shop had 150 pencils. It sold 45 in the morning and 38 in the afternoon. How many are left? _____

2. Hina buys 3 notebooks at 40 rupees each. She pays with 200 rupees. How much change does she get? _____ rupees

3. There are 5 rows of 6 chairs. 7 chairs are empty. How many people are sitting? _____

More free worksheets **littletakhti.netlify.app**

ANSWER KEY

Name _____ Date _____

Maths · Bar models

Part-Whole Bar Models

Find the missing number in each bar.

1.

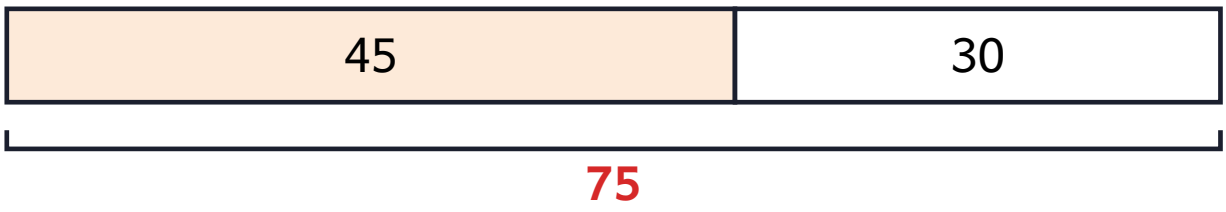

2.

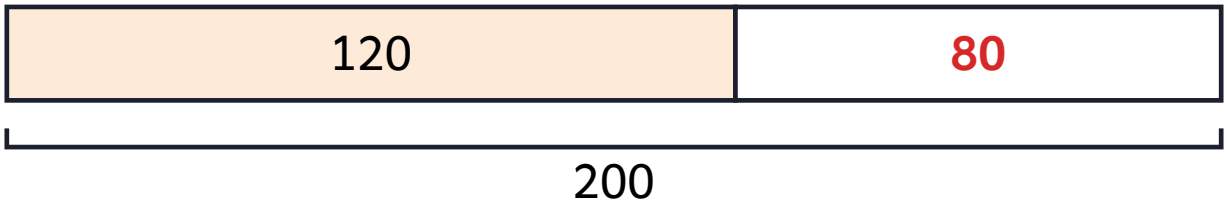

3.

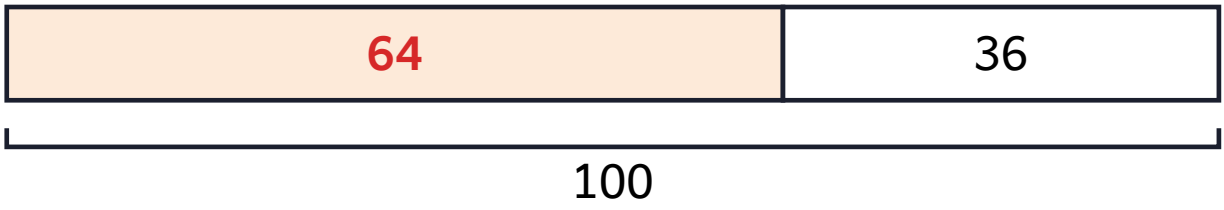

Write the number sentence.

1. 45 + 30 = **75**

2. 200 − 120 = **80**

ANSWER KEY

Name _____ Date _____

Maths · Bar models

Comparison Problems

Draw a bar model to help you.

1. Ali has 35 marbles. Bilal has 12 more than Ali. How many does Bilal have? **47**

2. A red ribbon is 90 cm long. A blue ribbon is 25 cm shorter. How long is the blue ribbon? **65** cm

3. Sara read 48 pages. Zara read 60 pages. How many more pages did Zara read? **12**

ANSWER KEY

Name _____ Date _____

Maths · Bar models

Two-Step Problems

Draw a bar model, then solve.

1. A shop had 150 pencils. It sold 45 in the morning and 38 in the afternoon. How many are left? **67**

2. Hina buys 3 notebooks at 40 rupees each. She pays with 200 rupees. How much change does she get? **80** rupees

3. There are 5 rows of 6 chairs. 7 chairs are empty. How many people are sitting? **23**