Name _____ Date _____

Maths · Shapes all around

Name the Shape

Circle the shape that matches the name.

1. circle



2. triangle



3. square



4. star



More free worksheets **littletakhti.netlify.app**

Name _____ Date _____

Maths · Shapes all around

Shapes at Home

What shape is it? Circle.

1. a roti — circle | square
2. a window — square | triangle
3. a samosa — triangle | circle
4. a clock — circle | square
5. a slice of cake — triangle | circle
6. a carrom board — square | circle

More free worksheets **littletakhti.netlify.app**

Name _____ Date _____

Maths · Shapes all around

Count the Sides

How many sides? Write the number.

1. A triangle has _____ sides.

2. A square has _____ sides.

3. A rectangle has _____ sides.

4. A circle has _____ straight sides.

Draw a house using shapes.

ANSWER KEY

Name _____ Date _____

Maths · Shapes all around

Name the Shape

Circle the shape that matches the name.

1. circle



2. triangle



3. square



4. star



More free worksheets **littletakhti.netlify.app**

ANSWER KEY

Name _____ Date _____

Maths · Shapes all around

Shapes at Home

What shape is it? Circle.

1. a roti — **circle** / square
2. a window — **square** / triangle
3. a samosa — **triangle** / circle
4. a clock — **circle** / square
5. a slice of cake — **triangle** / circle
6. a carrom board — **square** / circle

ANSWER KEY

Name _____ Date _____

Maths · Shapes all around

Count the Sides

How many sides? Write the number.

1. A triangle has **3** sides.

2. A square has **4** sides.

3. A rectangle has **4** sides.

4. A circle has **0** straight sides.

Draw a house using shapes.

Drawings will vary.