Name _____ Date _____

Maths · Numbers to 20

Count and Write

Count the shapes in each box. Write the number.

1.  = ☐

2. 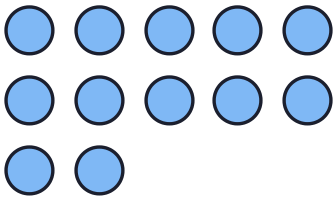 = ☐

3.  = ☐

4.  = ☐

5.  = ☐

6. 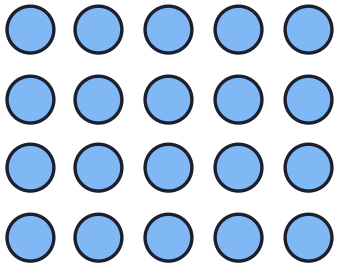 = ☐

7.  = ☐

8. 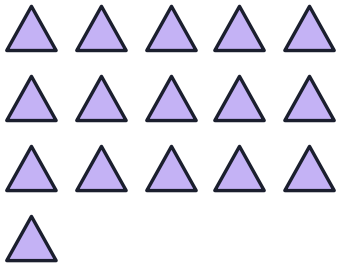 = ☐

Name _____ Date _____

Maths · Number bonds

Number Bonds to 10

Two parts make the whole. Write the missing number.

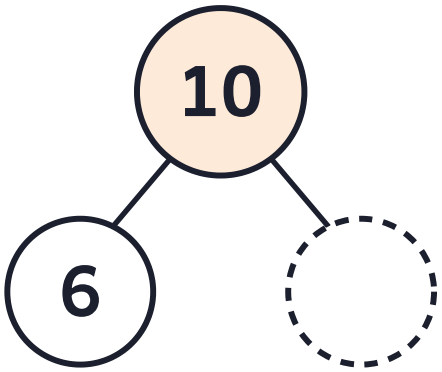

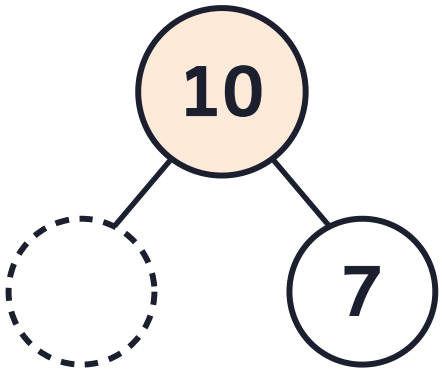

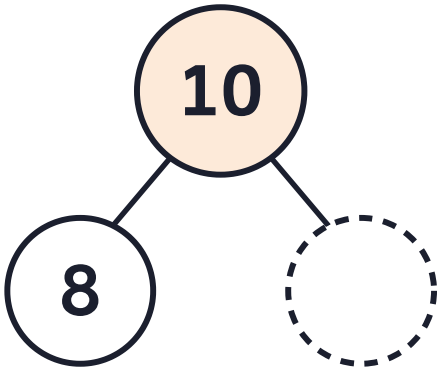

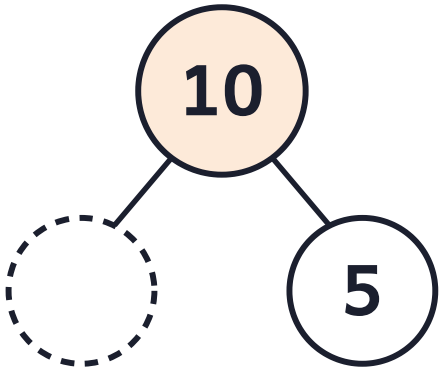

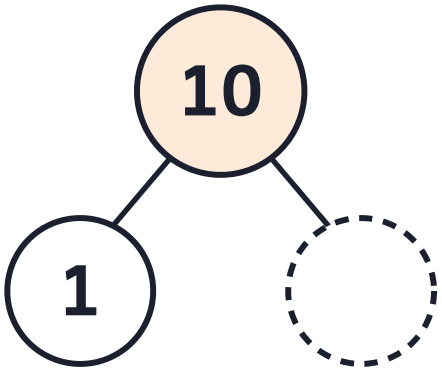

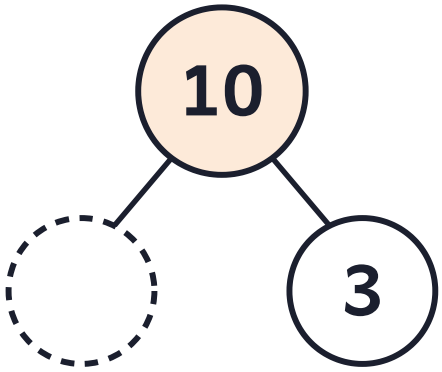

Complete the number sentences.

1. 4 + _____ = 10

2. _____ + 8 = 10

3. 9 + _____ = 10

4. _____ + 5 = 10

5. 3 + _____ = 10

6. _____ + 0 = 10

Name _____ Date _____

Maths · Addition

Adding Within 10

Add the pictures, then solve the sums.

A. Count and add.

1. 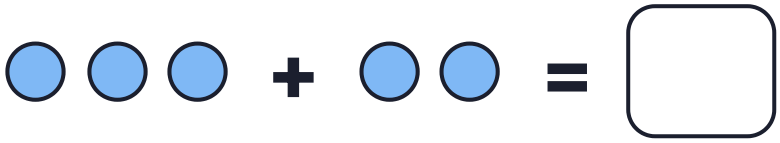

2. 

3. 

B. Solve.

1. 3 + 4 = _____
2. 5 + 2 = _____
3. 6 + 3 = _____
4. 1 + 8 = _____
5. 4 + 4 = _____
6. 2 + 7 = _____
7. 5 + 5 = _____
8. 0 + 6 = _____
9. 7 + 1 = _____

Name _____ Date _____

Maths · Subtraction

Taking Away Within 10

Cross out the shapes to take away. Write how many are left.

A. Cross out and write.

1. 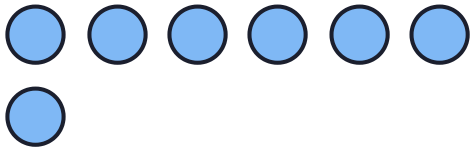 7 − 3 = ☐

2.  9 − 4 = ☐

3.  6 − 5 = ☐

B. Solve.

1. 9 − 4 = _____

2. 6 − 2 = _____

3. 10 − 7 = _____

4. 8 − 8 = _____

5. 5 − 1 = _____

6. 10 − 5 = _____

More free worksheets **littletakhti.netlify.app**

Name _____ Date _____

Maths · 2 times table

The 2 Times Table

Count the groups of 2, then complete the table.

A. How many groups? How many in all?

1.  ____ groups of 2 = ____

2. 

____ groups of 2 = ____

3. 

____ groups of 2 = ____

B. Complete the table.

1. 1 × 2 = ____
2. 6 × 2 = ____
3. 2 × 2 = ____
4. 7 × 2 = ____
5. 3 × 2 = ____
6. 8 × 2 = ____
7. 4 × 2 = ____
8. 9 × 2 = ____
9. 5 × 2 = ____
10. 10 × 2 = ____

Name _____ Date _____

Maths · Shapes and lines

Flat Shapes

Count the sides and corners.

1. triangle: _____ sides, _____ corners

2. square: _____ sides, _____ corners

3. rectangle: _____ sides, _____ corners

4. circle: _____ sides, _____ corners

More free worksheets **littletakhti.netlify.app**

Name _____ Date _____

Maths · Money

Pakistani Coins and Notes

Write the value.

1. One coin: Rs _____

2. Two coin: Rs _____

3. Five coin: Rs _____

4. Ten note or coin: Rs _____

5. Twenty note: Rs _____

6. Fifty note: Rs _____

More free worksheets **littletakhti.netlify.app**

Name _____ Date _____

Maths · Time

O'Clock

Write the time.

1.



2.



3.



4.



5.



6.



Name _____ Date _____

Maths · Measuring

Longer or Shorter?

Circle the longer one.

1. a pencil a bus

2. a spoon a broom

3. a train a car

4. a rope a button

More free worksheets **littletakhti.netlify.app**

Name _____ Date _____

Maths · Number names to 20

Number Names 0 to 10

Write the number name.

zero one two three four five six seven eight nine ten

1. 0 = _____

2. 3 = _____

3. 5 = _____

4. 7 = _____

5. 8 = _____

6. 10 = _____

More free worksheets **littletakhti.netlify.app**

ANSWER KEY

Name _____ Date _____

Maths · Numbers to 20

Count and Write

Count the shapes in each box. Write the number.

1.  = 7

2. 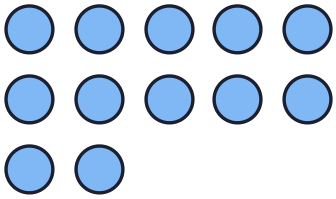 = 12

3.  = 9

4.  = 15

5.  = 18

6. 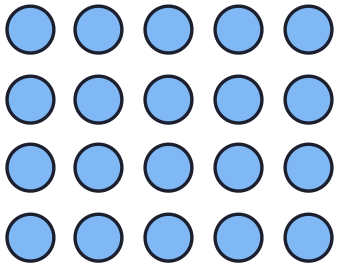 = 20

7.  = 11

8. 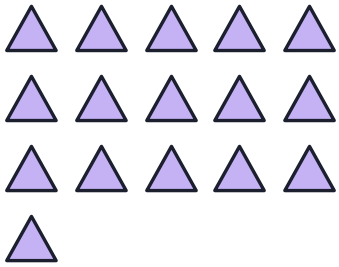 = 16

ANSWER KEY

Name _____ Date _____

Maths · Number bonds

Number Bonds to 10

Two parts make the whole. Write the missing number.

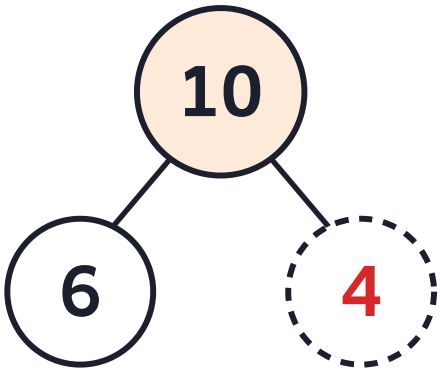

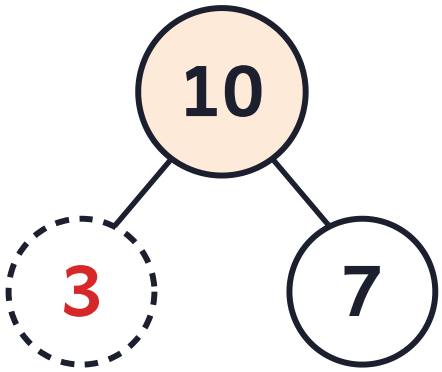

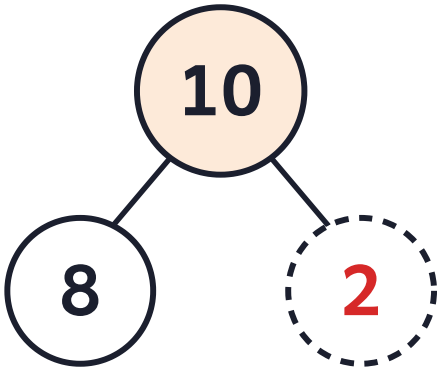

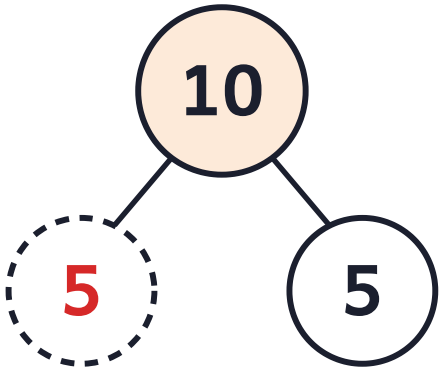

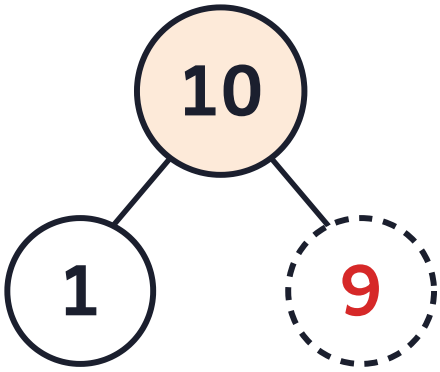

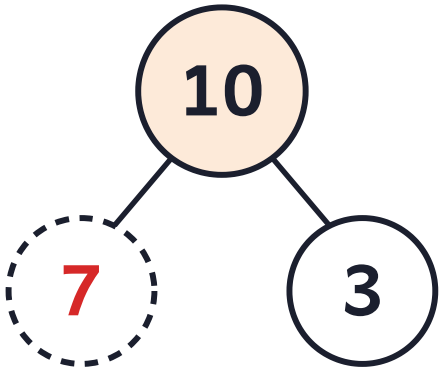

Complete the number sentences.

1. 4 + 6 = 10
2. 2 + 8 = 10
3. 9 + 1 = 10
4. 5 + 5 = 10
5. 3 + 7 = 10
6. 10 + 0 = 10

More free worksheets **littletakhti.netlify.app**

ANSWER KEY

Name _____ Date _____

Maths · Addition

Adding Within 10

Add the pictures, then solve the sums.

A. Count and add.

1.  = 5

2.  = 7

3.  = 9

B. Solve.

1. 3 + 4 = 7
2. 5 + 2 = 7
3. 6 + 3 = 9
4. 1 + 8 = 9
5. 4 + 4 = 8
6. 2 + 7 = 9
7. 5 + 5 = 10
8. 0 + 6 = 6
9. 7 + 1 = 8

More free worksheets **littletakhti.netlify.app**

ANSWER KEY

Name _____ Date _____

Maths · Subtraction

Taking Away Within 10

Cross out the shapes to take away. Write how many are left.

A. Cross out and write.

1. 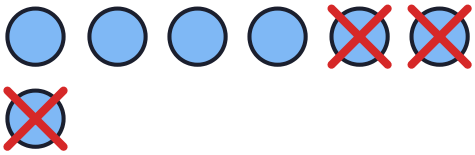 7 – 3 = **4**

2.  9 – 4 = **5**

3.  6 – 5 = **1**

B. Solve.

1. 9 – 4 = **5**
2. 6 – 2 = **4**
3. 10 – 7 = **3**
4. 8 – 8 = **0**
5. 5 – 1 = **4**
6. 10 – 5 = **5**

ANSWER KEY

Name _____ Date _____

Maths · 2 times table

The 2 Times Table

Count the groups of 2, then complete the table.

A. How many groups? How many in all?

1.  3 groups of 2 = 6

2. 

5 groups of 2 = 10

3. 

4 groups of 2 = 8

B. Complete the table.

1. 1 × 2 = 2
2. 6 × 2 = 12
3. 2 × 2 = 4
4. 7 × 2 = 14
5. 3 × 2 = 6
6. 8 × 2 = 16
7. 4 × 2 = 8
8. 9 × 2 = 18
9. 5 × 2 = 10
10. 10 × 2 = 20

ANSWER KEY

Name _____ Date _____

Maths · Shapes and lines

Flat Shapes

Count the sides and corners.

1. triangle: 3 sides, 3 corners
2. square: 4 sides, 4 corners
3. rectangle: 4 sides, 4 corners
4. circle: 0 sides, 0 corners

More free worksheets **littletakhti.netlify.app**

ANSWER KEY

Name _____ Date _____

Maths · Money

Pakistani Coins and Notes

Write the value.

1. One coin: Rs 1

2. Two coin: Rs 2

3. Five coin: Rs 5

4. Ten note or coin: Rs 10

5. Twenty note: Rs 20

6. Fifty note: Rs 50

More free worksheets **littletakhti.netlify.app**

ANSWER KEY

Name _____ Date _____

Maths · Time

O'Clock

Write the time.

1.



3 o'clock

2.



7 o'clock

3.



12 o'clock

4.



9 o'clock

5.



1 o'clock

6.



5 o'clock

ANSWER KEY

Name _____ Date _____

Maths · Measuring

Longer or Shorter?

Circle the longer one.

1. a pencil **a bus**

2. a spoon **a broom**

3. **a train** a car

4. **a rope** a button

More free worksheets **littletakhti.netlify.app**

ANSWER KEY

Name _____ Date _____

Maths · Number names to 20

Number Names 0 to 10

Write the number name.

zero one two three four five six seven eight nine ten

1. 0 = zero

2. 3 = three

3. 5 = five

4. 7 = seven

5. 8 = eight

6. 10 = ten

More free worksheets **littletakhti.netlify.app**