Name _____ Date _____

Maths · Numbers to 20

Count and Write

Count the shapes in each box. Write the number.

1.  = ☐

2. 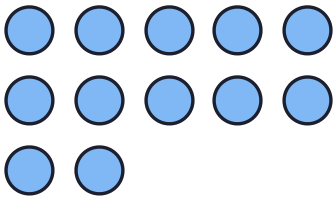 = ☐

3.  = ☐

4.  = ☐

5.  = ☐

6. 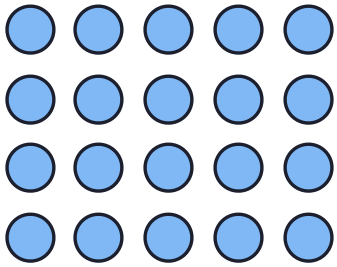 = ☐

7.  = ☐

8. 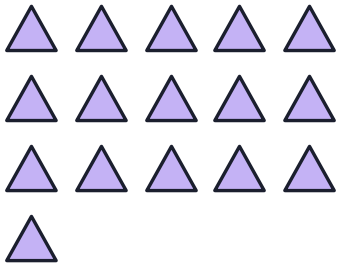 = ☐

Name _____ Date _____

Maths · Numbers to 20

Missing Numbers

Fill in the missing numbers on each number track.

A. Count forwards.

1	2		4	5		7		9	10
11		13	14		16	17		19	

B. Count backwards.

20	19		17	16		14		12	11
10		8		6	5		3		1

C. Count in twos.

2	4		8		12		16		20

D. Write the numbers in words.

1. 3 = _____

2. 7 = _____

3. 10 = _____

4. 12 = _____

Name _____ Date _____

Maths · Numbers to 20

Before, After, Between

Write the number that comes just before and just after.

A. Before and after.

	5			12			17	
	10			14			19	

B. Circle the bigger number.

1. 14 or 11 — 14 11
2. 9 or 16 — 9 16
3. 20 or 18 — 20 18
4. 7 or 17 — 7 17

C. Circle the smaller number.

1. 13 or 15 — 13 15
2. 19 or 10 — 19 10
3. 6 or 8 — 6 8

Name _____ Date _____

Maths · Number bonds

Number Bonds to 10

Two parts make the whole. Write the missing number.

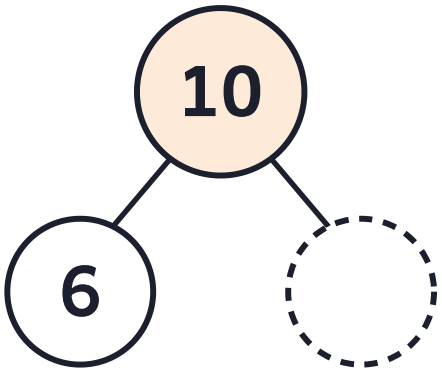

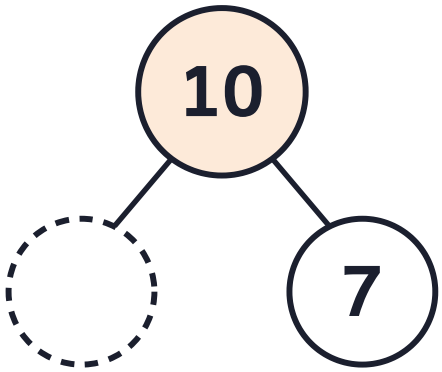

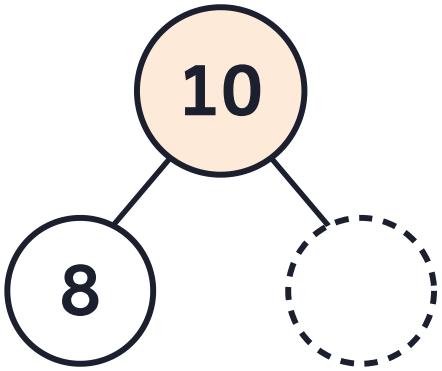

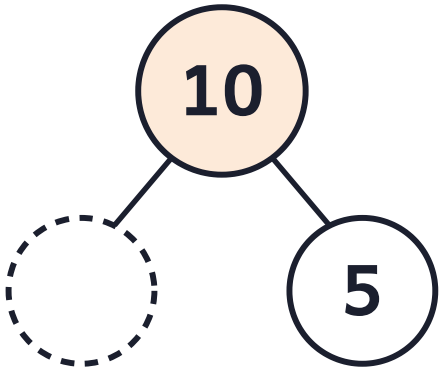

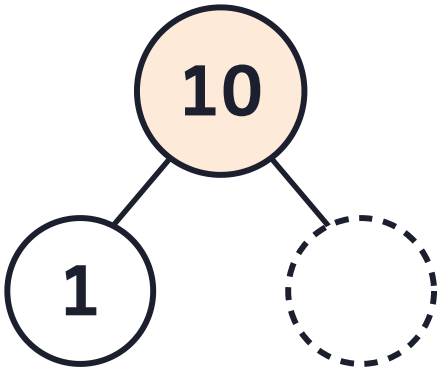

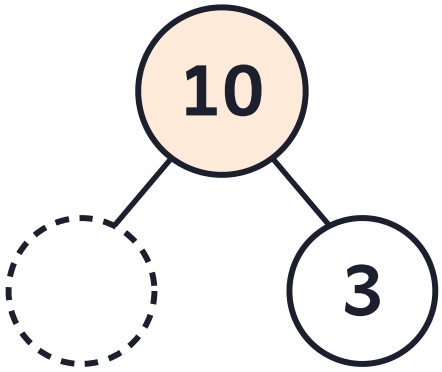

Complete the number sentences.

1. 4 + _____ = 10

2. _____ + 8 = 10

3. 9 + _____ = 10

4. _____ + 5 = 10

5. 3 + _____ = 10

6. _____ + 0 = 10

Name _____ Date _____

Maths · Number bonds

Number Bonds to 20

Write the missing part or whole.

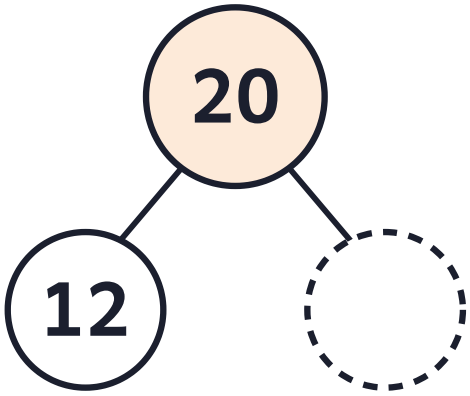

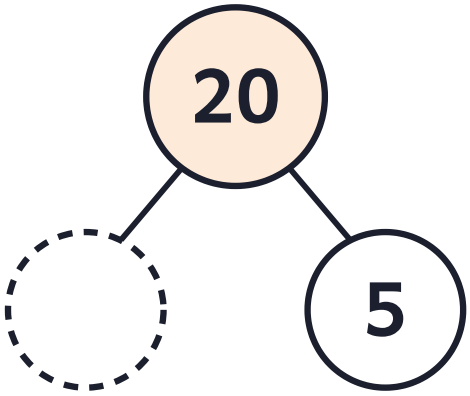

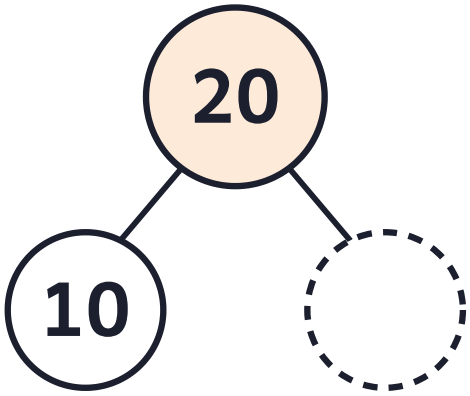

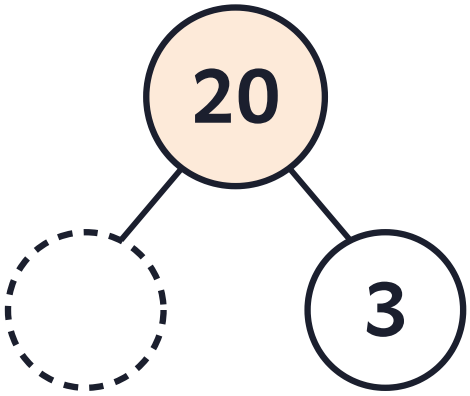

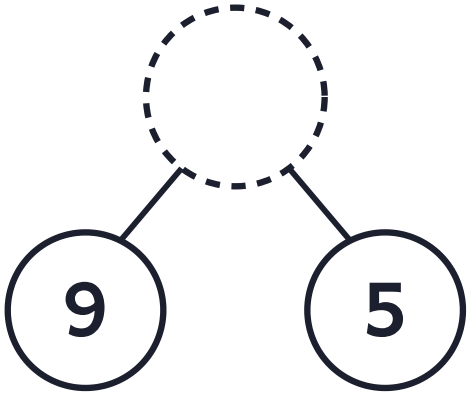

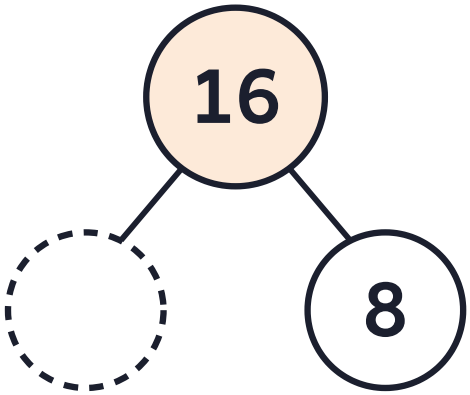

Make 20.

1. 11 + _____ = 20

2. _____ + 14 = 20

3. 13 + _____ = 20

4. _____ + 18 = 20

Name _____ Date _____

Maths · Addition

Adding Within 10

Add the pictures, then solve the sums.

A. Count and add.

1. 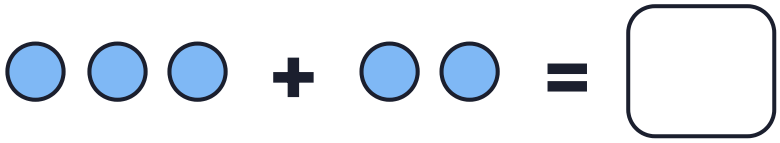

2. 

3. 

B. Solve.

1. 3 + 4 = _____
2. 5 + 2 = _____
3. 6 + 3 = _____
4. 1 + 8 = _____
5. 4 + 4 = _____
6. 2 + 7 = _____
7. 5 + 5 = _____
8. 0 + 6 = _____
9. 7 + 1 = _____

Name _____ Date _____

Maths · Addition

Adding Within 20

Use the number line to help you add.



A. Solve.

1. 10 + 5 = _____

2. 12 + 3 = _____

3. 8 + 6 = _____

4. 9 + 9 = _____

5. 11 + 7 = _____

6. 13 + 4 = _____

7. 7 + 7 = _____

8. 15 + 5 = _____

9. 6 + 8 = _____

B. Word problems.

1. Ali has 8 marbles. Sara gives him 5 more. How many marbles does Ali have now? _____

2. There are 9 mangoes in a basket and 6 on the table. How many mangoes are there in all? _____

Name _____ Date _____

Maths · Subtraction

Taking Away Within 10

Cross out the shapes to take away. Write how many are left.

A. Cross out and write.

1. 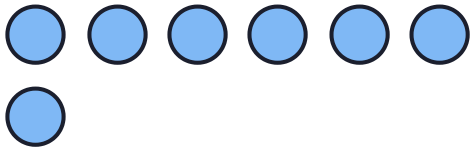 7 − 3 = ☐

2.  9 − 4 = ☐

3.  6 − 5 = ☐

B. Solve.

1. 9 − 4 = _____

2. 6 − 2 = _____

3. 10 − 7 = _____

4. 8 − 8 = _____

5. 5 − 1 = _____

6. 10 − 5 = _____

More free worksheets **littletakhti.netlify.app**

Name _____ Date _____

Maths · Subtraction

Subtracting Within 20

Solve the subtraction sums and word problems.

A. Solve.

1. 15 – 5 = _____
2. 18 – 6 = _____
3. 20 – 10 = _____
4. 14 – 3 = _____
5. 17 – 9 = _____
6. 12 – 4 = _____
7. 19 – 7 = _____
8. 16 – 8 = _____
9. 13 – 6 = _____

B. Word problems.

1. There are 16 birds on a tree. 7 fly away. How many birds are left? _____
2. Hina had 20 rupees. She spent 8 rupees on a pencil. How much money is left? _____ rupees
3. A box has 14 crayons. 5 are broken. How many crayons are not broken? _____

More free worksheets **littletakhti.netlify.app**

Name _____ Date _____

Maths · 2 times table

The 2 Times Table

Count the groups of 2, then complete the table.

A. How many groups? How many in all?

1.  ____ groups of 2 = ____

2. 

____ groups of 2 = ____

3. 

____ groups of 2 = ____

B. Complete the table.

1. 1 × 2 = ____
2. 6 × 2 = ____
3. 2 × 2 = ____
4. 7 × 2 = ____
5. 3 × 2 = ____
6. 8 × 2 = ____
7. 4 × 2 = ____
8. 9 × 2 = ____
9. 5 × 2 = ____
10. 10 × 2 = ____

ANSWER KEY

Name _____ Date _____

Maths · Numbers to 20

Count and Write

Count the shapes in each box. Write the number.

1.  = 7

2. 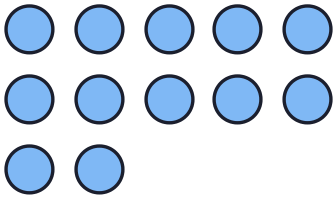 = 12

3.  = 9

4.  = 15

5.  = 18

6. 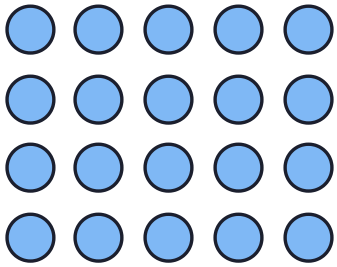 = 20

7.  = 11

8. 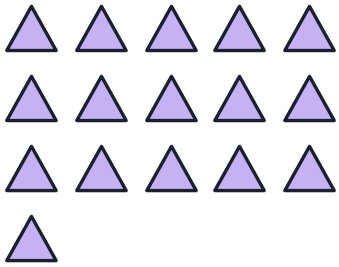 = 16

ANSWER KEY

Name _____ Date _____

Maths · Numbers to 20

Missing Numbers

Fill in the missing numbers on each number track.

A. Count forwards.

1	2	**3**	4	5	**6**	7	**8**	9	10
11	**12**	13	14	**15**	16	17	**18**	19	**20**

B. Count backwards.

20	19	**18**	17	16	**15**	14	**13**	12	11
10	**9**	8	**7**	6	5	**4**	3	**2**	1

C. Count in twos.

2	4	**6**	8	**10**	12	**14**	16	**18**	20

D. Write the numbers in words.

1. 3 = **three**
2. 7 = **seven**
3. 10 = **ten**
4. 12 = **twelve**

More free worksheets **littletakhti.netlify.app**

ANSWER KEY

Name _____ Date _____

Maths · Numbers to 20

Before, After, Between

Write the number that comes just before and just after.

A. Before and after.

4	5	6	11	12	13	16	17	18
9	10	11	13	14	15	18	19	20

B. Circle the bigger number.

1. 14 or 11 — **14**, 11
2. 9 or 16 — 9, **16**
3. 20 or 18 — **20**, 18
4. 7 or 17 — 7, **17**

C. Circle the smaller number.

1. 13 or 15 — **13**, 15
2. 19 or 10 — 19, **10**
3. 6 or 8 — **6**, 8

ANSWER KEY

Name _____ Date _____

Maths · Number bonds

Number Bonds to 10

Two parts make the whole. Write the missing number.

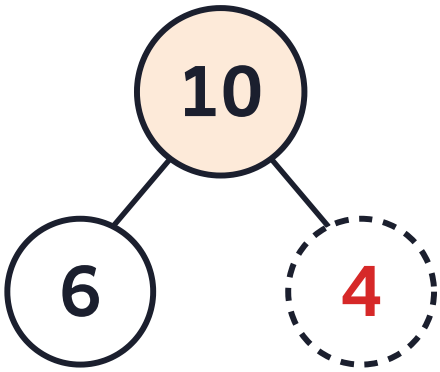

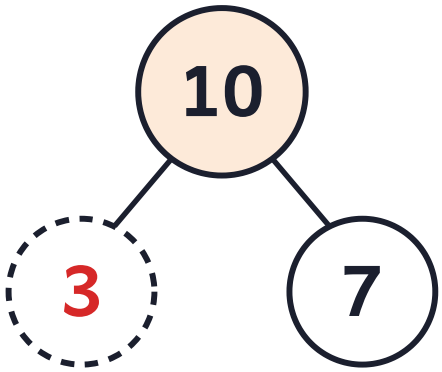

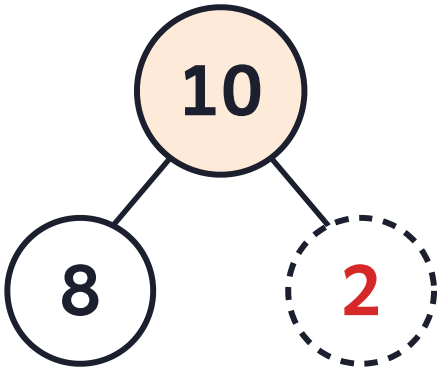

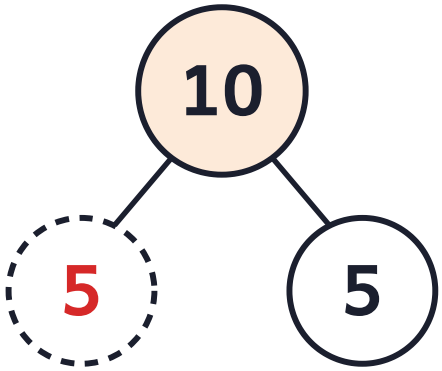

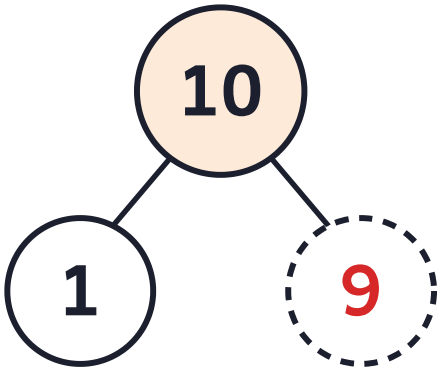

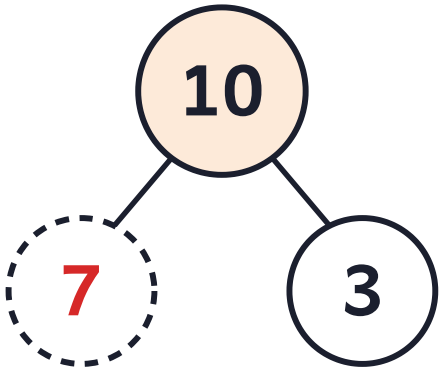

Complete the number sentences.

1. 4 + 6 = 10
2. 2 + 8 = 10
3. 9 + 1 = 10
4. 5 + 5 = 10
5. 3 + 7 = 10
6. 10 + 0 = 10

ANSWER KEY

Name _____ Date _____

Maths · Number bonds

Number Bonds to 20

Write the missing part or whole.

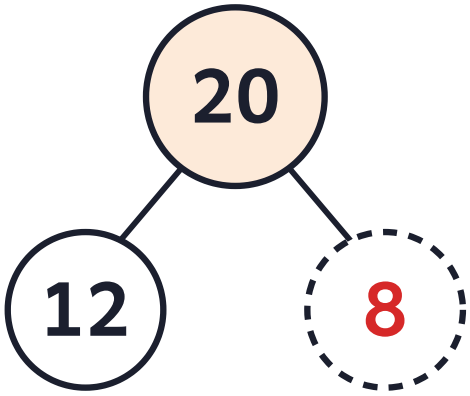

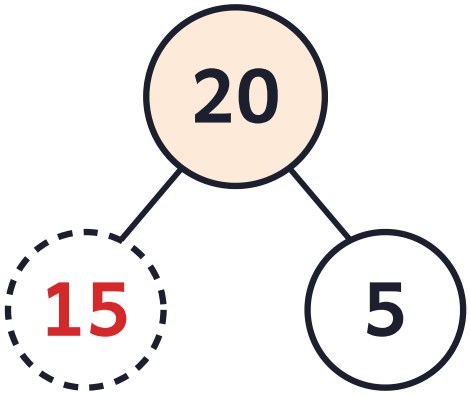

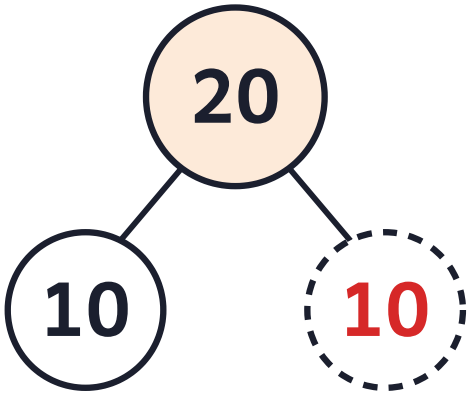

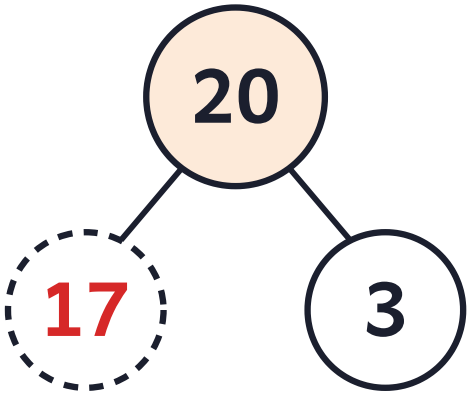

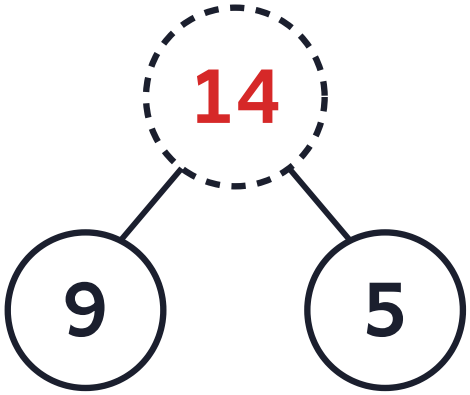

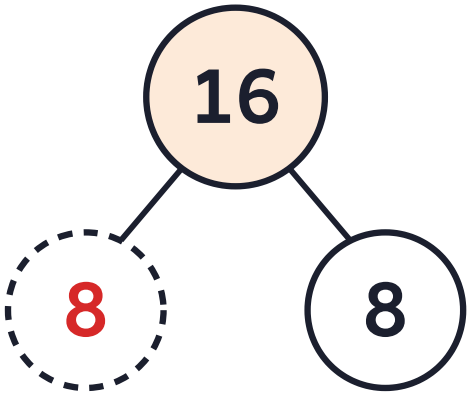

Make 20.

1. 11 + 9 = 20

2. 6 + 14 = 20

3. 13 + 7 = 20

4. 2 + 18 = 20

More free worksheets **littletakhti.netlify.app**

ANSWER KEY

Name _____ Date _____

Maths · Addition

Adding Within 10

Add the pictures, then solve the sums.

A. Count and add.

1.  = 5

2.  = 7

3.  = 9

B. Solve.

1. 3 + 4 = 7
2. 5 + 2 = 7
3. 6 + 3 = 9
4. 1 + 8 = 9
5. 4 + 4 = 8
6. 2 + 7 = 9
7. 5 + 5 = 10
8. 0 + 6 = 6
9. 7 + 1 = 8

ANSWER KEY

Name _____ Date _____

Maths · Addition

Adding Within 20

Use the number line to help you add.

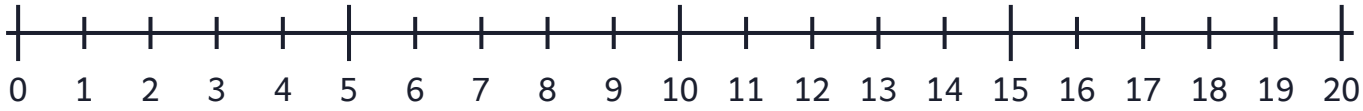

A. Solve.

1. 10 + 5 = **15**
2. 12 + 3 = **15**
3. 8 + 6 = **14**
4. 9 + 9 = **18**
5. 11 + 7 = **18**
6. 13 + 4 = **17**
7. 7 + 7 = **14**
8. 15 + 5 = **20**
9. 6 + 8 = **14**

B. Word problems.

1. Ali has 8 marbles. Sara gives him 5 more. How many marbles does Ali have now? **13**
2. There are 9 mangoes in a basket and 6 on the table. How many mangoes are there in all? **15**

ANSWER KEY

Name _____ Date _____

Maths · Subtraction

Taking Away Within 10

Cross out the shapes to take away. Write how many are left.

A. Cross out and write.

1. 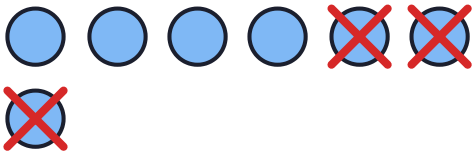 7 – 3 = **4**

2.  9 – 4 = **5**

3.  6 – 5 = **1**

B. Solve.

1. 9 – 4 = **5**
2. 6 – 2 = **4**
3. 10 – 7 = **3**
4. 8 – 8 = **0**
5. 5 – 1 = **4**
6. 10 – 5 = **5**

ANSWER KEY

Name _____ Date _____

Maths · Subtraction

Subtracting Within 20

Solve the subtraction sums and word problems.

A. Solve.

1. 15 – 5 = 10
2. 18 – 6 = 12
3. 20 – 10 = 10
4. 14 – 3 = 11
5. 17 – 9 = 8
6. 12 – 4 = 8
7. 19 – 7 = 12
8. 16 – 8 = 8
9. 13 – 6 = 7

B. Word problems.

1. There are 16 birds on a tree. 7 fly away. How many birds are left? 9
2. Hina had 20 rupees. She spent 8 rupees on a pencil. How much money is left? 12 rupees
3. A box has 14 crayons. 5 are broken. How many crayons are not broken? 9

ANSWER KEY

Name _____ Date _____

Maths · 2 times table

The 2 Times Table

Count the groups of 2, then complete the table.

A. How many groups? How many in all?

1.  3 groups of 2 = 6

2. 

5 groups of 2 = 10

3. 

4 groups of 2 = 8

B. Complete the table.

1. 1 × 2 = 2
2. 6 × 2 = 12
3. 2 × 2 = 4
4. 7 × 2 = 14
5. 3 × 2 = 6
6. 8 × 2 = 16
7. 4 × 2 = 8
8. 9 × 2 = 18
9. 5 × 2 = 10
10. 10 × 2 = 20