Name _____ Date _____

Maths · Number bonds

Number Bonds to 10

Two parts make the whole. Write the missing number.

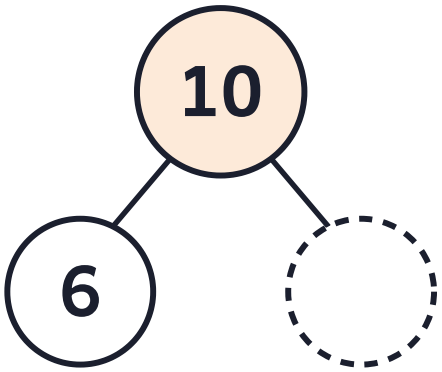

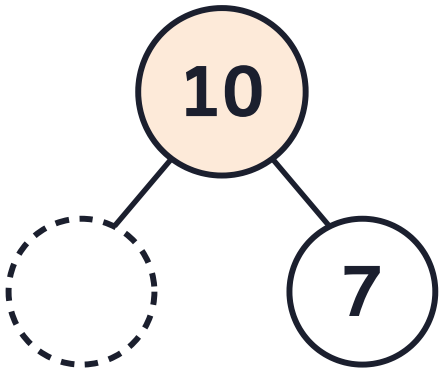

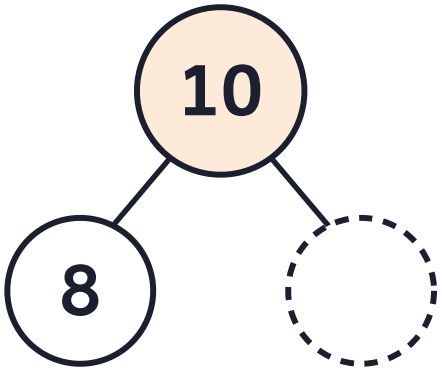

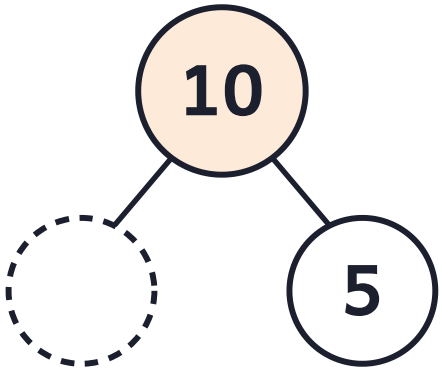

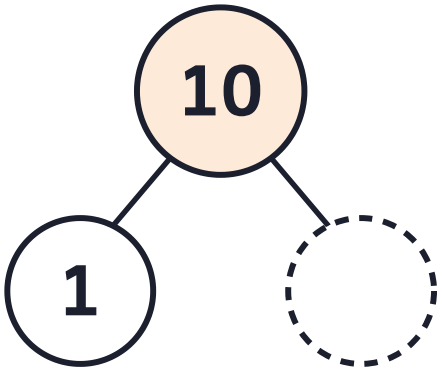

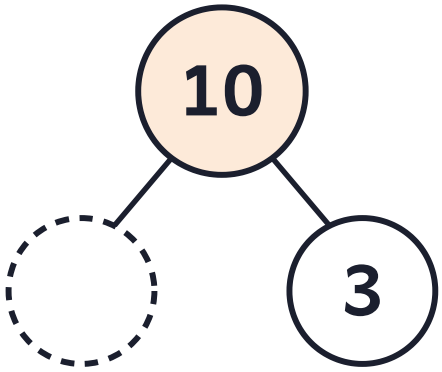

Complete the number sentences.

1. 4 + _____ = 10

2. _____ + 8 = 10

3. 9 + _____ = 10

4. _____ + 5 = 10

5. 3 + _____ = 10

6. _____ + 0 = 10

Name _____ Date _____

Maths · Number bonds

Number Bonds to 20

Write the missing part or whole.

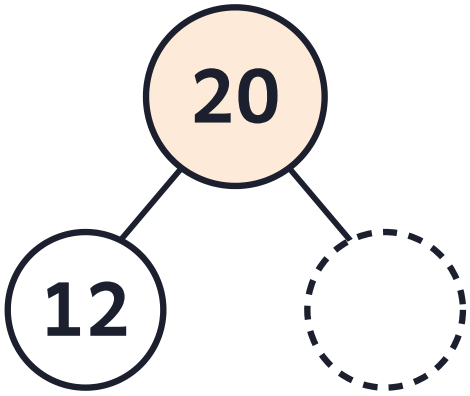

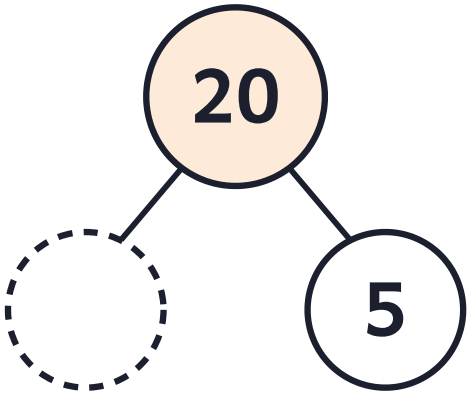

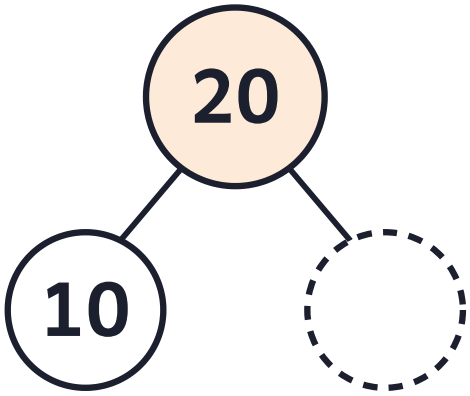

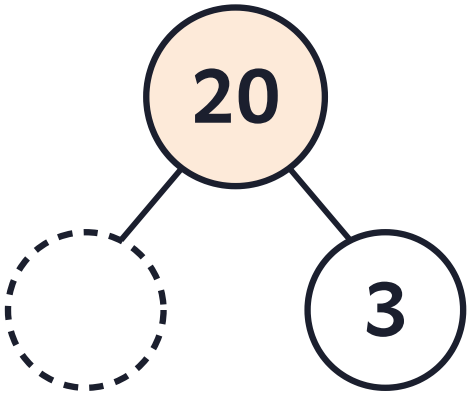

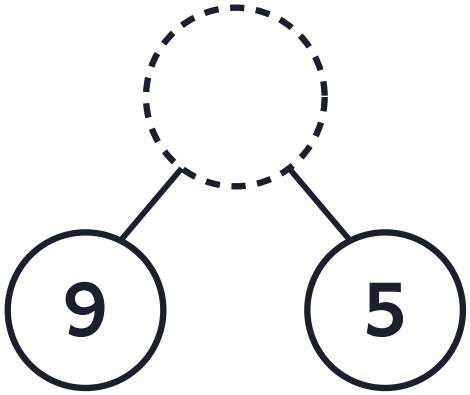

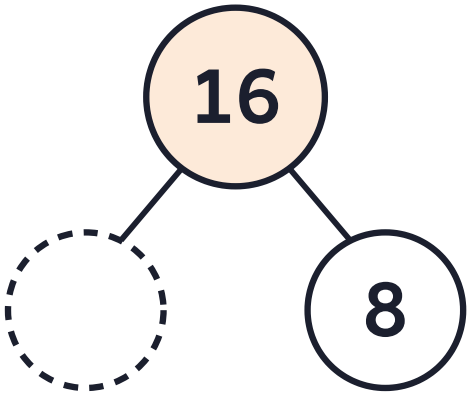

Make 20.

1. 11 + _____ = 20

2. _____ + 14 = 20

3. 13 + _____ = 20

4. _____ + 18 = 20

Name _____ Date _____

Maths · Number bonds

Number Bond Practice

Find the missing part to complete each bond.

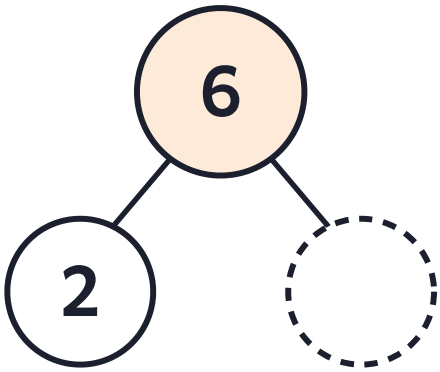

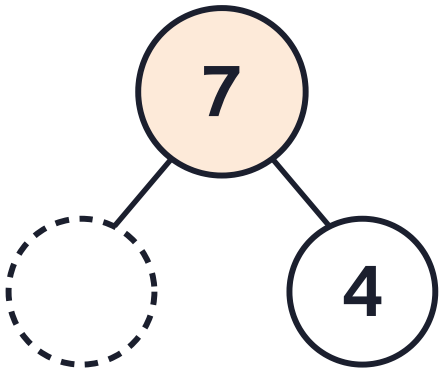

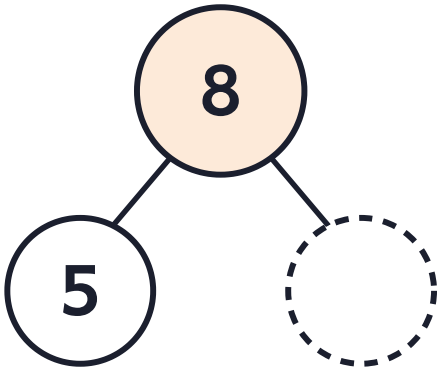

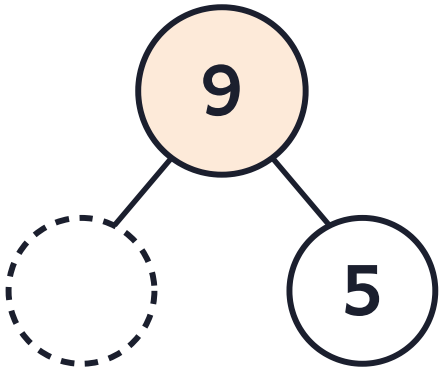

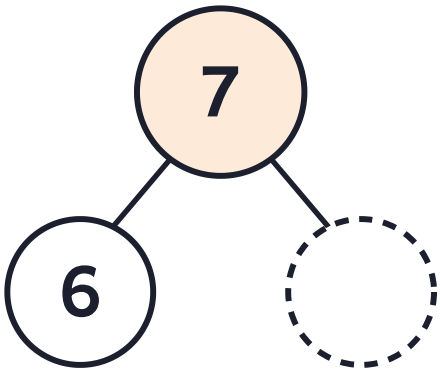

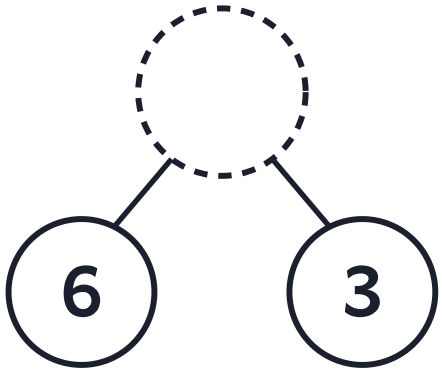

Complete the number sentences.

1. 3 + _____ = 6

2. _____ + 4 = 8

3. 5 + _____ = 7

4. _____ + 8 = 9

5. 2 + _____ = 8

6. _____ + 4 = 7

Name _____ Date _____

Maths · Number bonds

How Many More to Make 10?

Write how many more you need to make 10.

A. How many more to make 10?

1. 7 → _____
2. 4 → _____
3. 9 → _____
4. 2 → _____
5. 5 → _____
6. 6 → _____
7. 8 → _____
8. 3 → _____
9. 1 → _____

B. Word problems.

1. Sana has 6 bangles. How many more does she need to have 10? _____
2. There are 3 children in the van. It can take 10. How many more can get in? _____

ANSWER KEY

Name _____ Date _____

Maths · Number bonds

Number Bonds to 10

Two parts make the whole. Write the missing number.

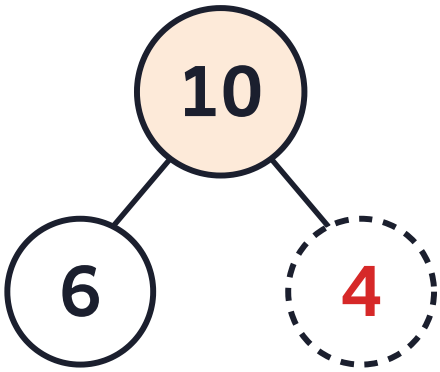

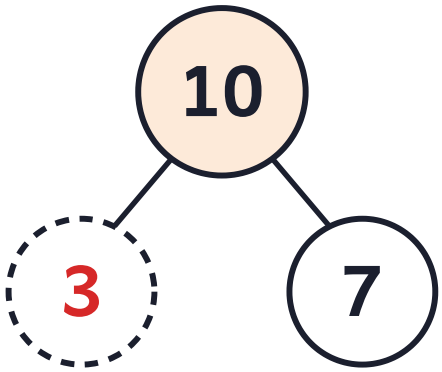

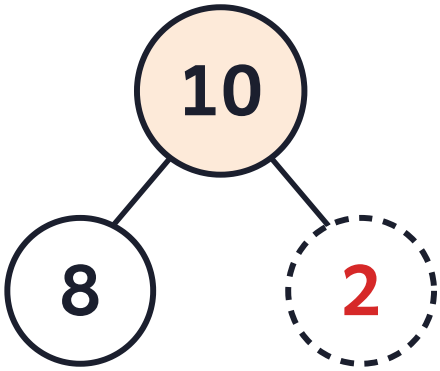

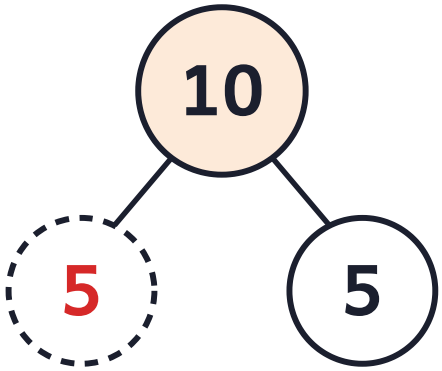

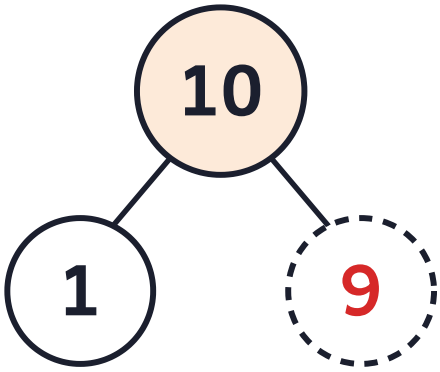

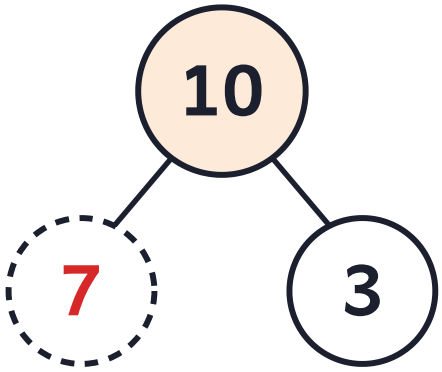

Complete the number sentences.

1. 4 + 6 = 10
2. 2 + 8 = 10
3. 9 + 1 = 10
4. 5 + 5 = 10
5. 3 + 7 = 10
6. 10 + 0 = 10

More free worksheets **littletakhti.netlify.app**

ANSWER KEY

Name _____ Date _____

Maths · Number bonds

Number Bonds to 20

Write the missing part or whole.

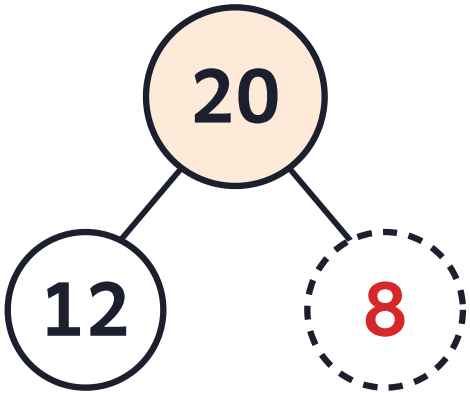

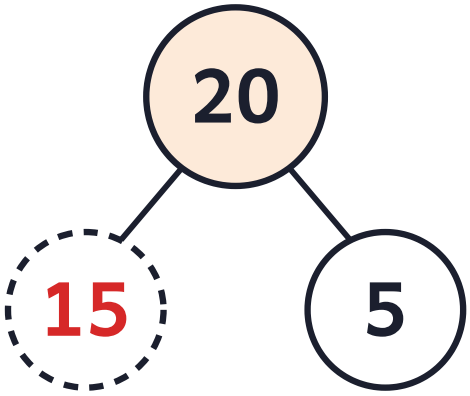

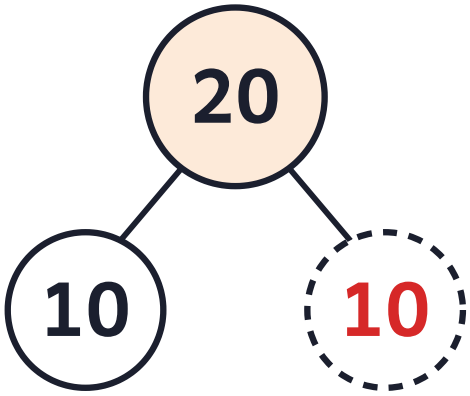

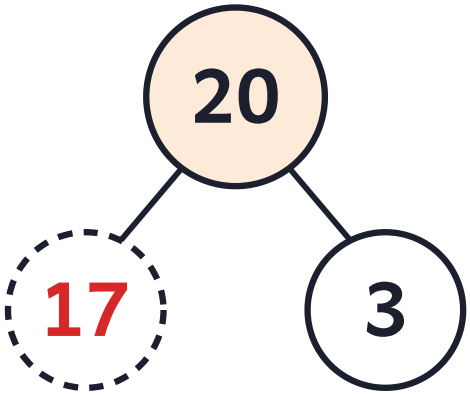

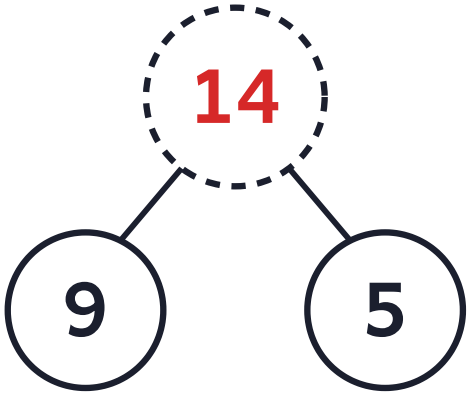

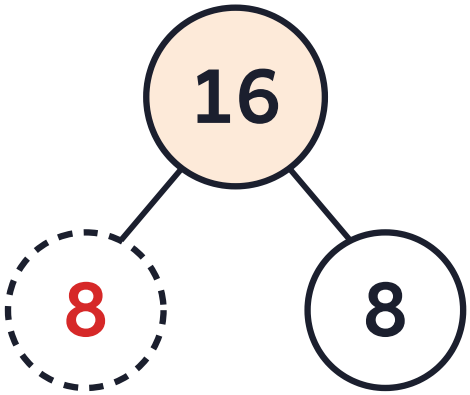

Make 20.

1. 11 + 9 = 20

2. 6 + 14 = 20

3. 13 + 7 = 20

4. 2 + 18 = 20

ANSWER KEY

Name _____ Date _____

Maths · Number bonds

Number Bond Practice

Find the missing part to complete each bond.

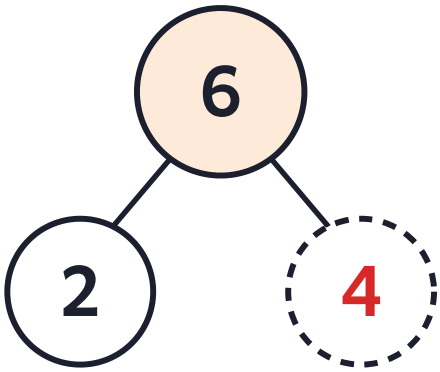

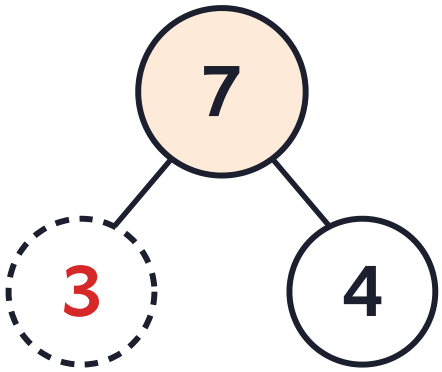

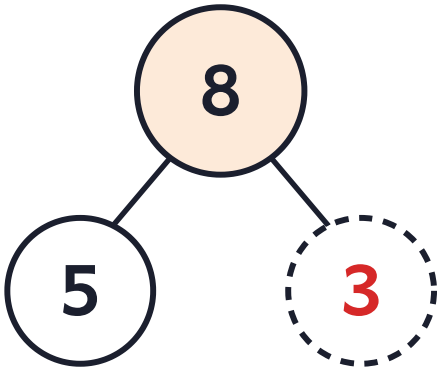

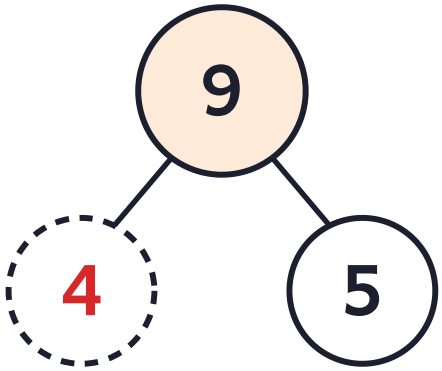

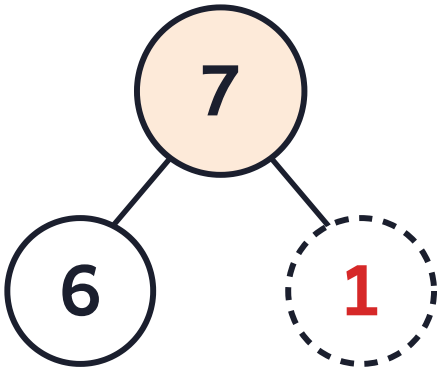

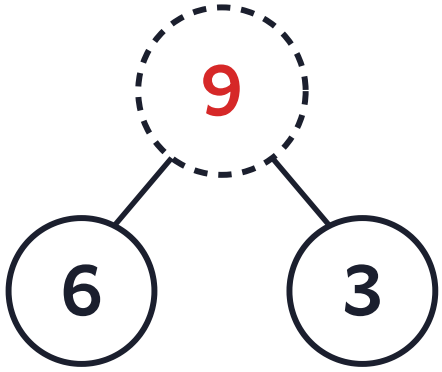

Complete the number sentences.

1. 3 + 3 = 6
2. 4 + 4 = 8
3. 5 + 2 = 7
4. 1 + 8 = 9
5. 2 + 6 = 8
6. 3 + 4 = 7

More free worksheets **littletakhti.netlify.app**

ANSWER KEY

Name _____ Date _____

Maths · Number bonds

How Many More to Make 10?

Write how many more you need to make 10.

A. How many more to make 10?

1. 7 → 3
2. 4 → 6
3. 9 → 1
4. 2 → 8
5. 5 → 5
6. 6 → 4
7. 8 → 2
8. 3 → 7
9. 1 → 9

B. Word problems.

1. Sana has 6 bangles. How many more does she need to have 10? 4

2. There are 3 children in the van. It can take 10. How many more can get in? 7

More free worksheets **littletakhti.netlify.app**