Name _____ Date _____

Maths · Practice paper

Maths Practice Paper (1)

Answer every question. A grown-up reads each question aloud and marks it out of 112.

Score: _____ / 112

★ 0 to 55 keep practising ★★ 56 to 86 good work ★★★ 87 to 112 super!

1. Count and write the number. (4 marks)

1.  = ☐

2.  = ☐

3. 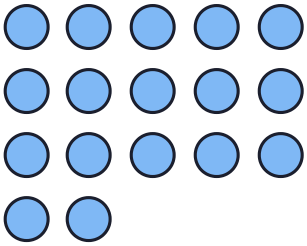 = ☐

4.  = ☐

2. Write the missing numbers. (4 marks)

10	11		13		15
16		18		20	

3. Circle the bigger number. (3 marks)

1. 11 or 15 — 11 15

2. 18 or 13 — 18 13

3. 20 or 16 — 20 16

Name _____ Date _____

Maths · Practice paper

Maths Practice Paper (2)

Look at each picture carefully before you circle.

4. Circle big or small. (4 marks)

1.  an elephant — big small
2.  an ant — big small
3.  a whale — big small
4.  a mouse — big small

5. Circle tall or short. (2 marks)

1.  a giraffe — tall short
2.  a little plant — tall short

6. Circle the right shape. (4 marks)

1. circle 
2. triangle 
3. square 
4. star 

Name _____ Date _____

Maths · Practice paper

Maths Practice Paper (3)

Count each group, then add.

7. Count and add. (4 marks)

1.  = ☐

2.  = ☐

3.  = ☐

4.  = ☐

8. Add. (4 marks)

1. 1 + 1 = _____

2. 2 + 3 = _____

3. 4 + 2 = _____

4. 3 + 3 = _____

9. How many sides? (2 marks)

1. A triangle has ... sides. 3 4

2. A square has ... sides. 3 4

10. Draw 3 circles and 2 triangles. (2 marks)

Name _____ Date _____

Maths · Practice paper

Maths Practice Paper (4)

A grown-up reads the word problems aloud. Keep going: this paper has ten pages.

11. Circle the group with more. (2 marks)

1. 

2. 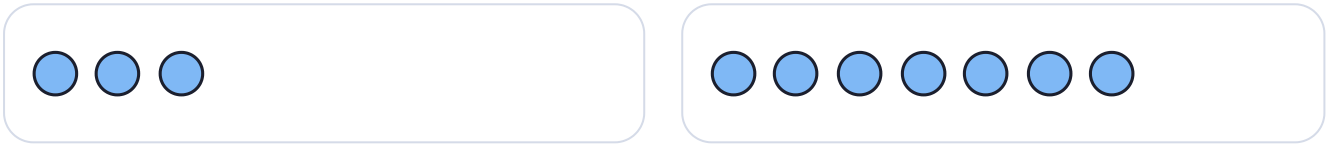

12. Word problems. (4 marks)

1. Ali has 2 red balloons and 2 blue balloons. How many balloons does he have? _____

2. There are 3 ducks in the pond. 1 more comes. How many ducks are there now? _____

3. Sara has 5 apples. Hamza has 3 apples. Who has more? _____

4. Dada buys 2 oranges and 3 bananas. How many fruits does he buy? _____

13. Count back. Fill in. (4 marks)

10	9		7	
15		13	12	

Name _____ Date _____

Maths · Practice paper

Maths Practice Paper (5)

Count carefully. Touch each picture as you count.

14. Count and write the number. (4 marks)

1.  = ☐

2.  = ☐

3. 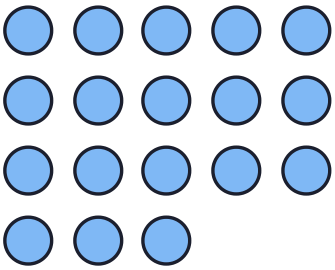 = ☐

4.  = ☐

15. What comes next? (6 marks)

1. 12, 13, _____

2. 16, 17, _____

3. 9, 10, _____

4. 18, 19, _____

5. 5, 6, _____

6. 13, 14, _____

16. Circle the smaller number. (4 marks)

1. 12 or 19 — (12) (19)

2. 17 or 14 — (17) (14)

3. 20 or 11 — (20) (11)

4. 8 or 15 — (8) (15)

Name _____ Date _____

Maths · Practice paper

Maths Practice Paper (6)

Look at the size of each thing.

17. Circle big or small. (4 marks)

1.  a bus — big small
2.  a ladybird — big small
3.  a house — big small
4.  cherries — big small

18. Circle tall or short. (4 marks)

1.  a tree — tall short
2.  a mushroom — tall short
3.  a building — tall short
4.  a hut — tall short

19. Circle the right word. (3 marks)

1. An elephant is ... than a cat. — bigger smaller
2. A mouse is ... than a cow. — bigger smaller
3. A giraffe is ... than a goat. — taller shorter

Name _____ Date _____

Maths · Practice paper

Maths Practice Paper (7)

Shapes are all around us.



Shapes around us

A circle is round and has no corners. A square has 4 equal sides and 4 corners. A triangle has 3 sides and 3 corners.

20. What shape is it? Circle. (4 marks)

1. a coin — circle | triangle | square
2. a slice of pizza — circle | triangle | square
3. a window — circle | triangle | square
4. a flag — circle | triangle | square

21. Circle the right shape. (3 marks)

1. circle



2. triangle



3. square



22. How many corners? (3 marks)

1. A triangle has ____ corners.
2. A square has ____ corners.
3. A circle has ____ corners.

Name _____ Date _____

Maths · Practice paper

Maths Practice Paper (8)

Count both groups, then add them together.

23. Count and add. (4 marks)

1.  = ☐

2.  = ☐

3.  = ☐

4.  = ☐

24. Add. (6 marks)

1. 2 + 2 = _____
2. 1 + 4 = _____
3. 3 + 2 = _____
4. 5 + 1 = _____
5. 4 + 3 = _____
6. 2 + 6 = _____

25. Word problems. (3 marks)

1. There are 4 red cars and 3 blue cars. How many cars are there? _____

2. There are 3 cats and 2 dogs. How many pets are there? _____

3. Hina has 4 pencils. She gets 1 more. How many pencils does she have now? _____

Name _____ Date _____

Maths · Practice paper

Maths Practice Paper (9)

Count to 20. Ten and some more makes a teen number.

26. Count and write. (4 marks)

1.  = ☐

2.  = ☐

3. 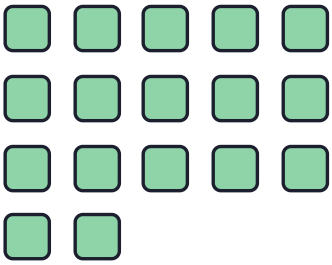 = ☐

4. 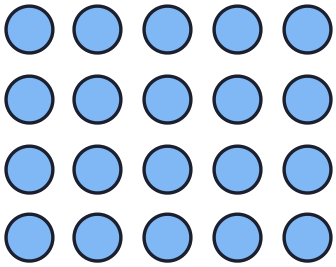 = ☐

27. Fill in the missing numbers. (5 marks)

11		13		15
16	17			

28. Ten and some more. Circle. (3 marks)

1. 10 and 3 more makes ... 13 30

2. 10 and 5 more makes ... 15 51

3. 10 and 8 more makes ... 80 18

Name _____ Date _____

Maths · Practice paper

Maths Practice Paper (10)

Think carefully. Add up your marks from all ten pages.

29. True or false? Circle. (4 marks)

1. 15 comes after 14. True False
2. A square is round. True False
3. 2 + 2 = 5 True False
4. A giraffe is tall. True False

30. Circle the group with more. (2 marks)

1. 
2. 

31. Think and solve. (3 marks)

1. I am the number after 9. What am I? _____

2. I am 1 more than 15. What am I? _____

3. Ali has 2 apples. Sara has 2 apples too. How many apples are there in all? _____

How did I do? Draw a smiley face or write one thing you can do now.

I can _____ .

ANSWER KEY

Name _____ Date _____

Maths · Practice paper

Maths Practice Paper (1)

Answer every question. A grown-up reads each question aloud and marks it out of 112.

Score: _____ / 112

★ 0 to 55 keep practising ★★ 56 to 86 good work ★★★ 87 to 112 super!

1. Count and write the number. (4 marks)

1.  = **11**

2.  = **14**

3. 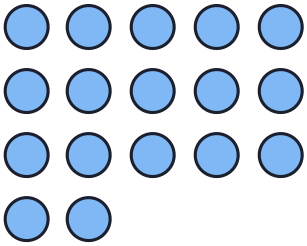 = **17**

4.  = **20**

2. Write the missing numbers. (4 marks)

10	11	**12**	13	**14**	15
16	**17**	18	**19**	20	

3. Circle the bigger number. (3 marks)

1. 11 or 15 — 11 **15**

2. 18 or 13 — **18** 13

3. 20 or 16 — **20** 16

ANSWER KEY

Name _____ Date _____

Maths · Practice paper

Maths Practice Paper (2)

Look at each picture carefully before you circle.

4. Circle big or small. (4 marks)

1. an elephant — **big** / small
2. an ant — big / **small**
3. a whale — **big** / small
4. a mouse — big / **small**

5. Circle tall or short. (2 marks)

1. a giraffe — **tall** / short
2. a little plant — tall / **short**

6. Circle the right shape. (4 marks)

1. circle



2. triangle



3. square



4. star



ANSWER KEY

Name _____ Date _____

Maths · Practice paper

Maths Practice Paper (3)

Count each group, then add.

7. Count and add. (4 marks)

1. ★★ + ★ = **3**

2. ♥♥♥ + ♥♥ = **5**

3. ●●●● + ● = **5**

4. ■■ + ■■ = **4**

8. Add. (4 marks)

1. 1 + 1 = **2**

2. 2 + 3 = **5**

3. 4 + 2 = **6**

4. 3 + 3 = **6**

9. How many sides? (2 marks)

1. A triangle has ... sides. **3** 4

2. A square has ... sides. 3 **4**

10. Draw 3 circles and 2 triangles. (2 marks)

Drawings will vary.

ANSWER KEY

Name _____ Date _____

Maths · Practice paper

Maths Practice Paper (4)

A grown-up reads the word problems aloud. Keep going: this paper has ten pages.

11. Circle the group with more. (2 marks)

1. 

2. 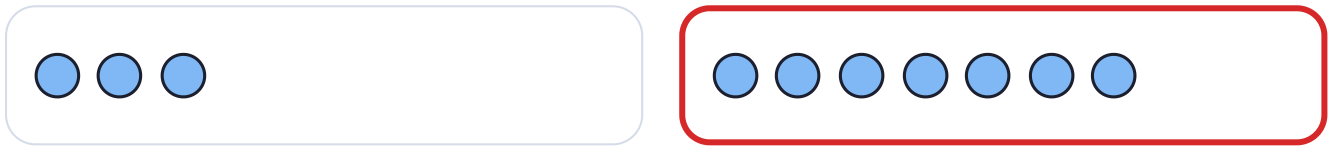

12. Word problems. (4 marks)

1. Ali has 2 red balloons and 2 blue balloons. How many balloons does he have? **4**

2. There are 3 ducks in the pond. 1 more comes. How many ducks are there now? **4**

3. Sara has 5 apples. Hamza has 3 apples. Who has more? **Sara**

4. Dada buys 2 oranges and 3 bananas. How many fruits does he buy? **5**

13. Count back. Fill in. (4 marks)

10	9	**8**	7	**6**
15	**14**	13	12	**11**

ANSWER KEY

Name _____ Date _____

Maths · Practice paper

Maths Practice Paper (5)

Count carefully. Touch each picture as you count.

14. Count and write the number. (4 marks)

1.  = 12

2.  = 15

3. 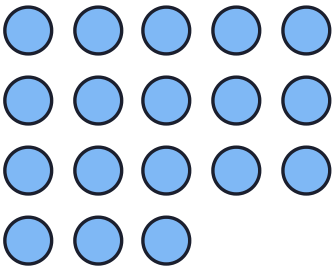 = 18

4.  = 13

15. What comes next? (6 marks)

1. 12, 13, 14
2. 16, 17, 18
3. 9, 10, 11
4. 18, 19, 20
5. 5, 6, 7
6. 13, 14, 15

16. Circle the smaller number. (4 marks)

1. 12 or 19 — **12** 19
2. 17 or 14 — 17 **14**
3. 20 or 11 — 20 **11**
4. 8 or 15 — **8** 15

ANSWER KEY

Name _____ Date _____

Maths · Practice paper

Maths Practice Paper (6)

Look at the size of each thing.

17. Circle big or small. (4 marks)

1.  a bus — **big** / small
2.  a ladybird — big / **small**
3.  a house — **big** / small
4.  cherries — big / **small**

18. Circle tall or short. (4 marks)

1.  a tree — **tall** / short
2.  a mushroom — tall / **short**
3.  a building — **tall** / short
4.  a hut — tall / **short**

19. Circle the right word. (3 marks)

1. An elephant is ... than a cat. — **bigger** / smaller
2. A mouse is ... than a cow. — bigger / **smaller**
3. A giraffe is ... than a goat. — **taller** / shorter

ANSWER KEY

Name _____ Date _____

Maths · Practice paper

Maths Practice Paper (7)

Shapes are all around us.



Shapes around us

A circle is round and has no corners. A square has 4 equal sides and 4 corners. A triangle has 3 sides and 3 corners.

20. What shape is it? Circle. (4 marks)

1. a coin — **circle** triangle square
2. a slice of pizza — circle **triangle** square
3. a window — circle triangle **square**
4. a flag — circle **triangle** square

21. Circle the right shape. (3 marks)

1. circle



2. triangle



3. square



22. How many corners? (3 marks)

1. A triangle has **3** corners.
2. A square has **4** corners.
3. A circle has **0** corners.

ANSWER KEY

Name _____ Date _____

Maths · Practice paper

Maths Practice Paper (8)

Count both groups, then add them together.

23. Count and add. (4 marks)

1.  = 4

2.  = 6

3.  = 7

4.  = 4

24. Add. (6 marks)

1. 2 + 2 = 4
2. 1 + 4 = 5
3. 3 + 2 = 5
4. 5 + 1 = 6
5. 4 + 3 = 7
6. 2 + 6 = 8

25. Word problems. (3 marks)

1. There are 4 red cars and 3 blue cars. How many cars are there? 7

2. There are 3 cats and 2 dogs. How many pets are there? 5

3. Hina has 4 pencils. She gets 1 more. How many pencils does she have now? 5

ANSWER KEY

Name _____ Date _____

Maths · Practice paper

Maths Practice Paper (9)

Count to 20. Ten and some more makes a teen number.

26. Count and write. (4 marks)

1.  = 16

2.  = 19

3. 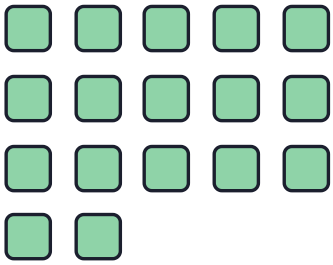 = 17

4. 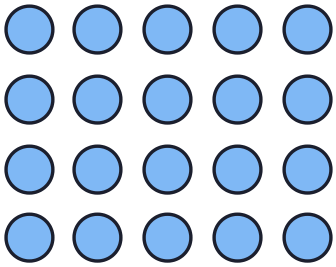 = 20

27. Fill in the missing numbers. (5 marks)

11	12	13	14	15
16	17	18	19	20

28. Ten and some more. Circle. (3 marks)

1. 10 and 3 more makes ... **13** 30

2. 10 and 5 more makes ... **15** 51

3. 10 and 8 more makes ... 80 **18**

ANSWER KEY

Name _____ Date _____

Maths · Practice paper

Maths Practice Paper (10)

Think carefully. Add up your marks from all ten pages.

29. True or false? Circle. (4 marks)

1. 15 comes after 14. **True** False
2. A square is round. True **False**
3. 2 + 2 = 5 True **False**
4. A giraffe is tall. **True** False

30. Circle the group with more. (2 marks)

1. 
2. 

31. Think and solve. (3 marks)

1. I am the number after 9. What am I? **10**
2. I am 1 more than 15. What am I? **16**
3. Ali has 2 apples. Sara has 2 apples too. How many apples are there in all? **4**

How did I do? Draw a smiley face or write one thing you can do now.

I can _____ .

Answers will vary.