Name _____ Date _____

Social Studies · Practice paper

Social Studies Practice Paper (1)

Answer every question. A grown-up can read the questions aloud. Mark it out of 115.

Score: _____ / 115

★ 0 to 56 keep practising ★★ 57 to 89 good work ★★★ 90 to 115 super!



Neighbourhood

A neighbourhood is the area around our home, with places we use.

1. Where do we go? Circle. (4 marks)

1. To buy bread, we go to the ... bakery hospital
2. When we are ill, we go to the ... park hospital
3. To post a letter, we go to the ... post office school
4. To play on the swings, we go to the ... shop park

2. Match the helper to the job. Write the letter in the box. (4 marks)

☐	1. doctor	a)	brings letters
☐	2. postman	b)	looks after sick people
☐	3. firefighter	c)	keeps us safe on the roads
☐	4. police officer	d)	puts out fires

3. True or false? Circle. (2 marks)

1. Good neighbours help each other. True False
2. We should throw litter in the street. True False

Name _____ Date _____

Social Studies · Practice paper

Social Studies Practice Paper (2)

Think about your school: the people, the places and the rules.

4. Who is it? Circle. (4 marks)

1. Who teaches us? teacher driver
2. Who looks after the school gate? cook guard
3. Who is in charge of the school? principal gardener
4. Who keeps the school clean? pilot cleaner

5. Match the place to what we do there. Write the letter in the box. (4 marks)

☐	1. library	a)	play games
☐	2. playground	b)	read books
☐	3. classroom	c)	buy food
☐	4. canteen	d)	learn lessons

6. Good or not good? Circle. (4 marks)

1.  running in the corridor good not good
2.  putting up my hand to speak good not good
3.  putting litter in the bin good not good
4.  shouting in class good not good

7. Write two things you like about your school. (2 marks)

1. _____ 2. _____

Name _____ Date _____

Social Studies · Practice paper

Social Studies Practice Paper (3)

Look at the map carefully. North is at the top.

Maps

A map is a drawing of a place seen from above. A key tells us what the symbols mean. N, S, E and W stand for north, south, east and west.

North

West

East

South

Bakery	Mosque	Park
School	My house	Hospital
Shop	Fire station	Post office

8. Use the map. Circle. (5 marks)

1. What is north of My house? Mosque Shop
2. What is south of My house? Bakery Fire station
3. What is east of My house? Hospital School
4. What is west of My house? Park School
5. What is in the top right corner? Park Shop

Name _____ Date _____

Social Studies · Practice paper

Social Studies Practice Paper (4)

Think about maps, then draw your own. Keep going: this paper has ten pages.

above **key** **north**

9. Fill in. (3 marks)

1. A map shows a place from _____.
2. The _____ tells us what the symbols mean.
3. N stands for _____.

10. True or false? Circle. (4 marks)

1. A map can show roads and buildings.	True	False
2. North is at the top of most maps.	True	False
3. A map key tells us the time.	True	False
4. A compass helps us find directions.	True	False

11. Draw a map of your classroom. Add a key with three symbols. (4 marks)

12. Write the names of two places near your home. (2 marks)

1. _____ 2. _____

Name _____ Date _____

Social Studies · Practice paper

Social Studies Practice Paper (5)

Places in our neighbourhood help us.

hospital | mosque | school | shop | post office | bakery

13. Name the place. (6 marks)



1. _____



2. _____



3. _____



4. _____



5. _____



6. _____

14. Where do we go? Circle. (4 marks)

1. To say prayers, we go to the ... mosque bakery
2. To get medicine, we go to the ... park pharmacy
3. To catch a bus, we go to the ... bus stop library
4. To buy fruit, we go to the ... post office market

15. True or False? Circle. (2 marks)

1. A neighbourhood is the area around our home. True False
2. A hospital is a place to play cricket. True False

Name _____ Date _____

Social Studies · Practice paper

Social Studies Practice Paper (6)

Many people work to help our neighbourhood.

16. Match the helper to the job. Write the letter in the box. (5 marks)

☐	1. baker	a)	sews clothes
☐	2. tailor	b)	sells things
☐	3. farmer	c)	grows food
☐	4. teacher	d)	bakes bread
☐	5. shopkeeper	e)	helps us learn

17. What does each helper use? Circle. (4 marks)

1. A firefighter uses a … hose spoon
2. A doctor uses a … hammer stethoscope
3. A postman carries … letters bricks
4. A farmer drives a … rocket tractor

street **neighbours** **help**

18. Fill in. (3 marks)

1. People who live near us are our _____.
2. Good neighbours _____ each other.
3. We keep our _____ clean.

19. Write one way you can be a good neighbour. (2 marks)

_____

More free worksheets **littletakhti.com**

Name _____ Date _____

Social Studies · Practice paper

Social Studies Practice Paper (7)

Our school has many helpers and rules.



Our school

Our school has many people who help us: the principal, teachers, the guard, the cleaner and the gardener.

20. Match the person to the job. Write the letter in the box. (4 marks)

☐	1. principal	a)	teaches the class
☐	2. teacher	b)	runs the school
☐	3. guard	c)	looks after the plants
☐	4. gardener	d)	keeps the gate safe

21. Good or not good? Circle. (4 marks)

1. waiting for my turn	good	not good
2. pushing in the line	good	not good
3. saying thank you	good	not good
4. writing on desks	good	not good

22. Fill in. (3 marks)

1. We borrow books from the _____.
2. We buy lunch in the _____.
3. We learn lessons in the _____.

23. Write one rule we follow at school. (2 marks)

_____

Name _____ Date _____

Social Studies · Practice paper

Social Studies Practice Paper (8)

Look at the map carefully. North is at the top.

North

West

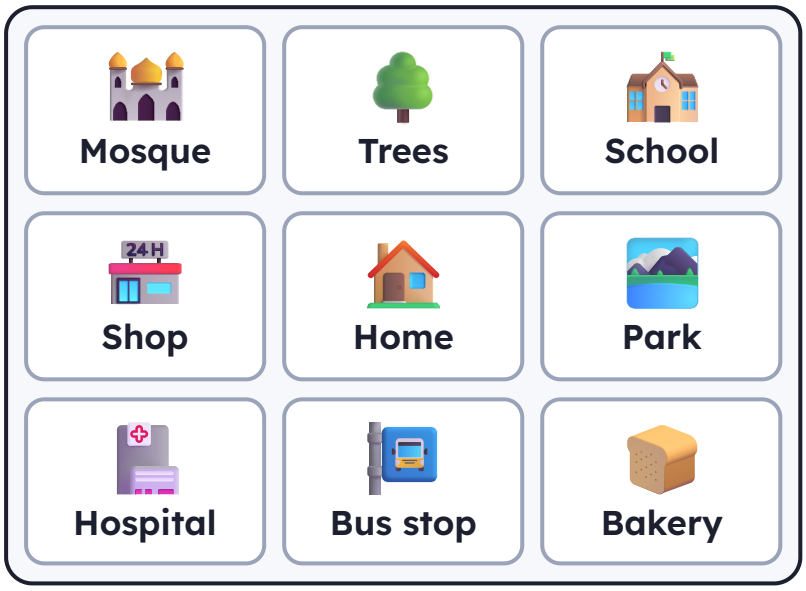

East

South

24. Use the map. Circle. (6 marks)

1. What is north of Home? Trees Bus stop
2. What is south of Home? Trees Bus stop
3. What is east of Home? Park Shop
4. What is west of Home? Park Shop
5. What is in the top left corner? Mosque Bakery
6. What is in the bottom right corner? Hospital Bakery

25. Fill in north, south, east or west. (2 marks)

1. The School is _____ of the Trees.
2. The Hospital is _____ of the Shop.

Name _____ Date _____

Social Studies · Practice paper

Social Studies Practice Paper (9)

A compass shows four directions.

26. Fill in. (4 marks)

1. N stands for _____.
2. S stands for _____.
3. E stands for _____.
4. W stands for _____.

27. Circle the right answer. (6 marks)

1. The sun rises in the ... east west
2. The sun sets in the ... north west
3. The opposite of north is ... south east
4. The opposite of east is ... north west
5. On a map, go up to go ... north south
6. On a map, go down to go ... east south

28. True or False? Circle. (3 marks)

1. A map shows a place from the side. True False
2. A key tells us what the symbols mean. True False
3. A map of our school can show the classrooms. True False

29. Draw a map symbol for a tree, a house and a road. (3 marks)

Name _____ Date _____

Social Studies · Practice paper

Social Studies Practice Paper (10)

Think carefully. Add up your marks from all ten pages.

30. True or false? Circle. (5 marks)

1. A baker bakes bread. True False
2. The principal runs the school. True False
3. We should throw litter on the road. True False
4. South is at the top of most maps. True False
5. A compass helps us find directions. True False

31. Spot the mistake. Circle the wrong one. (3 marks)

1. A doctor works in a hospital. / A doctor works in a bakery.
2. We read books in the library. / We swim in the library.
3. N stands for north. / N stands for night.

32. Write how you get from your classroom to the school gate. (2 marks)

_____

_____

How did I do? Write one thing you can do now.

I can _____ .

ANSWER KEY

Name _____ Date _____

Social Studies · Practice paper

Social Studies Practice Paper (1)

Answer every question. A grown-up can read the questions aloud. Mark it out of 115.

Score: _____ / 115

★ 0 to 56 keep practising ★★ 57 to 89 good work ★★★ 90 to 115 super!



Neighbourhood

A neighbourhood is the area around our home, with places we use.

1. Where do we go? Circle. (4 marks)

1. To buy bread, we go to the … **bakery** hospital
2. When we are ill, we go to the … park **hospital**
3. To post a letter, we go to the … **post office** school
4. To play on the swings, we go to the … shop **park**

2. Match the helper to the job. Write the letter in the box. (4 marks)

b	1. doctor	a) brings letters
a	2. postman	b) looks after sick people
d	3. firefighter	c) keeps us safe on the roads
c	4. police officer	d) puts out fires

3. True or false? Circle. (2 marks)

1. Good neighbours help each other. **True** False
2. We should throw litter in the street. True **False**

ANSWER KEY

Name _____ Date _____

Social Studies · Practice paper

Social Studies Practice Paper (2)

Think about your school: the people, the places and the rules.

4. Who is it? Circle. (4 marks)

1. Who teaches us? **teacher** driver
2. Who looks after the school gate? cook **guard**
3. Who is in charge of the school? **principal** gardener
4. Who keeps the school clean? pilot **cleaner**

5. Match the place to what we do there. Write the letter in the box. (4 marks)

b	1. library	a) play games
a	2. playground	b) read books
d	3. classroom	c) buy food
c	4. canteen	d) learn lessons

6. Good or not good? Circle. (4 marks)

1.  running in the corridor good **not good**
2.  putting up my hand to speak **good** not good
3.  putting litter in the bin **good** not good
4.  shouting in class good **not good**

7. Write two things you like about your school. (2 marks)

1. _____ 2. _____

Answers will vary.

ANSWER KEY

Name _____ Date _____

Social Studies · Practice paper

Social Studies Practice Paper (3)

Look at the map carefully. North is at the top.

Maps

A map is a drawing of a place seen from above. A key tells us what the symbols mean. N, S, E and W stand for north, south, east and west.

North

West

East

South

Bakery	Mosque	Park
School	My house	Hospital
Shop	Fire station	Post office

8. Use the map. Circle. (5 marks)

1. What is north of My house? **Mosque** Shop
2. What is south of My house? Bakery **Fire station**
3. What is east of My house? **Hospital** School
4. What is west of My house? Park **School**
5. What is in the top right corner? **Park** Shop

ANSWER KEY

Name _____ Date _____

Social Studies · Practice paper

Social Studies Practice Paper (4)

Think about maps, then draw your own. Keep going: this paper has ten pages.

above key north

9. Fill in. (3 marks)

1. A map shows a place from **above** .
2. The **key** tells us what the symbols mean.
3. N stands for **north** .

10. True or false? Circle. (4 marks)

1. A map can show roads and buildings.	**True**	False
2. North is at the top of most maps.	**True**	False
3. A map key tells us the time.	True	**False**
4. A compass helps us find directions.	**True**	False

11. Draw a map of your classroom. Add a key with three symbols. (4 marks)

Drawings will vary.

12. Write the names of two places near your home. (2 marks)

1. _____ 2. _____

Answers will vary.

ANSWER KEY

Name _____ Date _____

Social Studies · Practice paper

Social Studies Practice Paper (5)

Places in our neighbourhood help us.

hospital | mosque | school | shop | post office | bakery

13. Name the place. (6 marks)



1. hospital



2. mosque



3. school



4. shop



5. post office



6. bakery

14. Where do we go? Circle. (4 marks)

1. To say prayers, we go to the ... **mosque** bakery

2. To get medicine, we go to the ... park **pharmacy**

3. To catch a bus, we go to the ... **bus stop** library

4. To buy fruit, we go to the ... post office **market**

15. True or False? Circle. (2 marks)

1. A neighbourhood is the area around our home. **True** False

2. A hospital is a place to play cricket. True **False**

ANSWER KEY

Name _____ Date _____

Social Studies · Practice paper

Social Studies Practice Paper (6)

Many people work to help our neighbourhood.

16. Match the helper to the job. Write the letter in the box. (5 marks)

d	1. baker	a) sews clothes
a	2. tailor	b) sells things
c	3. farmer	c) grows food
e	4. teacher	d) bakes bread
b	5. shopkeeper	e) helps us learn

17. What does each helper use? Circle. (4 marks)

1. A firefighter uses a … **hose** spoon
2. A doctor uses a … hammer **stethoscope**
3. A postman carries … **letters** bricks
4. A farmer drives a … rocket **tractor**

street **neighbours** **help**

18. Fill in. (3 marks)

1. People who live near us are our **neighbours** .
2. Good neighbours **help** each other.
3. We keep our **street** clean.

19. Write one way you can be a good neighbour. (2 marks)

Answers will vary.

ANSWER KEY

Name _____ Date _____

Social Studies · Practice paper

Social Studies Practice Paper (7)

Our school has many helpers and rules.



Our school

Our school has many people who help us: the principal, teachers, the guard, the cleaner and the gardener.

20. Match the person to the job. Write the letter in the box. (4 marks)

b	1. principal	a) teaches the class
a	2. teacher	b) runs the school
d	3. guard	c) looks after the plants
c	4. gardener	d) keeps the gate safe

21. Good or not good? Circle. (4 marks)

1. waiting for my turn	**good**	not good
2. pushing in the line	good	**not good**
3. saying thank you	**good**	not good
4. writing on desks	good	**not good**

22. Fill in. (3 marks)

1. We borrow books from the **library** .
2. We buy lunch in the **canteen** .
3. We learn lessons in the **classroom** .

23. Write one rule we follow at school. (2 marks)

Answers will vary.

ANSWER KEY

Name _____ Date _____

Social Studies · Practice paper

Social Studies Practice Paper (8)

Look at the map carefully. North is at the top.

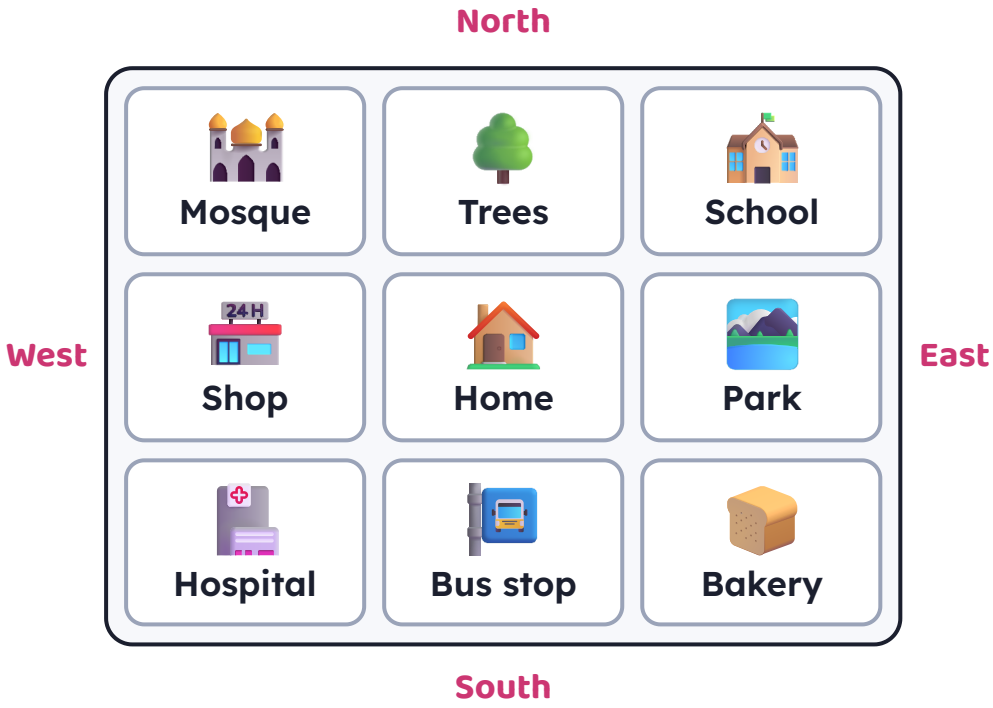

24. Use the map. Circle. (6 marks)

1. What is north of Home? **Trees** Bus stop
2. What is south of Home? Trees **Bus stop**
3. What is east of Home? **Park** Shop
4. What is west of Home? Park **Shop**
5. What is in the top left corner? **Mosque** Bakery
6. What is in the bottom right corner? Hospital **Bakery**

25. Fill in north, south, east or west. (2 marks)

1. The School is **east** of the Trees.
2. The Hospital is **south** of the Shop.

ANSWER KEY

Name _____ Date _____

Social Studies · Practice paper

Social Studies Practice Paper (9)

A compass shows four directions.

26. Fill in. (4 marks)

1. N stands for **north** .
2. S stands for **south** .
3. E stands for **east** .
4. W stands for **west** .

27. Circle the right answer. (6 marks)

1. The sun rises in the ... **east** west
2. The sun sets in the ... north **west**
3. The opposite of north is ... **south** east
4. The opposite of east is ... north **west**
5. On a map, go up to go ... **north** south
6. On a map, go down to go ... east **south**

28. True or False? Circle. (3 marks)

1. A map shows a place from the side. True **False**
2. A key tells us what the symbols mean. **True** False
3. A map of our school can show the classrooms. **True** False

29. Draw a map symbol for a tree, a house and a road. (3 marks)

Drawings will vary.

ANSWER KEY

Name _____ Date _____

Social Studies · Practice paper

Social Studies Practice Paper (10)

Think carefully. Add up your marks from all ten pages.

30. True or false? Circle. (5 marks)

1. A baker bakes bread. **True** False
2. The principal runs the school. **True** False
3. We should throw litter on the road. True **False**
4. South is at the top of most maps. True **False**
5. A compass helps us find directions. **True** False

31. Spot the mistake. Circle the wrong one. (3 marks)

1. A doctor works in a hospital. **A doctor works in a bakery.**
2. We read books in the library. **We swim in the library.**
3. N stands for north. **N stands for night.**

32. Write how you get from your classroom to the school gate. (2 marks)

Answers will vary.

How did I do? Write one thing you can do now.

I can _____ .

Answers will vary.